Find the Area of the following squares. Remember to use the formula: **S xS**

6cm



Area of □ = S x S
= 6 x 6
= 36 cm²

7cm



9cm



8cm



4cm



10cm



LIVEWORKSHEETS