# ÁNGULOS ENTRE PARALELAS Y UNA SECANTE

Encontrar el valor del ángulo **a**

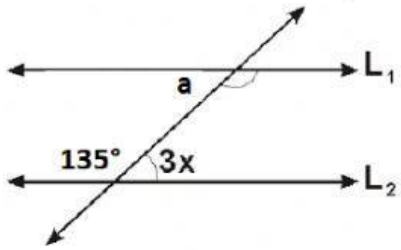


| | |
|---|---|
| **a =** | |

Encontrar el valor de los ángulos indicados con las expresiones algebraicas.

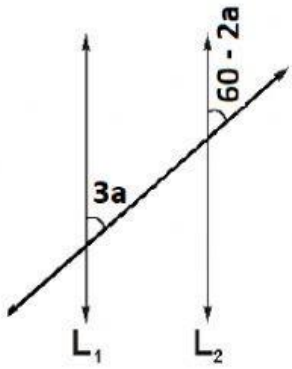


| | |
|---|---|
| 3a = | |
| 60-2a = | |

Encuentra el valor de los ángulos indicados

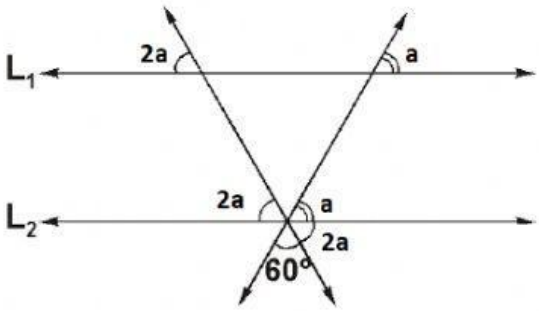


| | |
|---|---|
| 2a = | |
| a = | |

Encontrar el valor de **x**

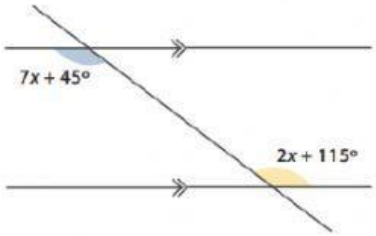


| | |
|---|---|
| **X =** | |

LIVEWORKSHEETS