Actividad de números racionales

Indicación: Une con una línea cada fracción, gráfico, decimal y cada recta numérica que representen el mismo número racional.

Fracción	Gráfico	Decimal	Recta numérica
$\frac{5}{7}$		2,75	
$\frac{6}{4}$	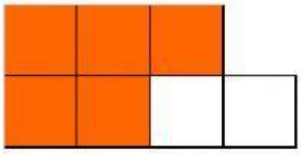	$0,\overline{7}$	
$\frac{7}{9}$	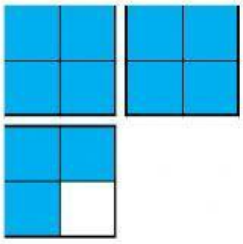	1,5	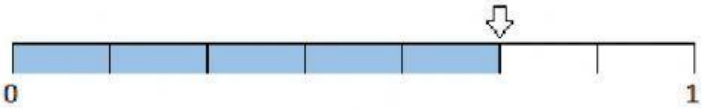
$\frac{11}{4}$		$0,\overline{714285}$	
$\frac{3}{7}$		$0,\overline{428571}$	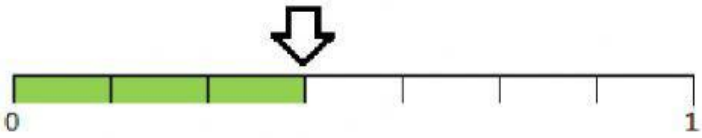
$\frac{12}{5}$	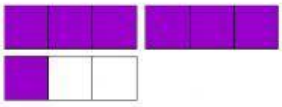	$2,\overline{3}$	
$\frac{3}{8}$		0,375	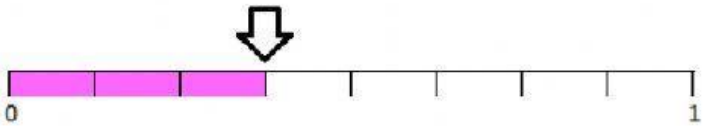
$\frac{7}{3}$	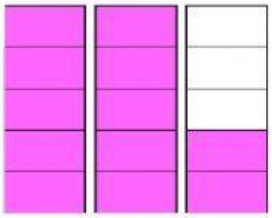	2,4	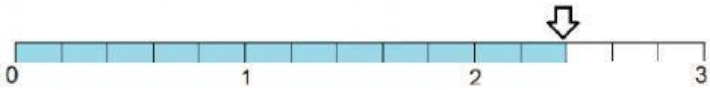

LIVEWORKSHEETS