1.Mass, which one has more mass? Escribe 1 para el mas pesado

Put the photographs in order from heavy to light. (De más pesado a ligero)



2. Volume, which one has more volume?



3.Complete the sentences

mass	mixtures	volume	metals

- **a) _____ is the space matter occupies.**
- **b) _____ is how heavy matter is.**
- **c) _____ such as iron, nickel and cobalt are attracted to magnets.**
- **d) _____ can be homogeneous or heterogeneous.**

4.Match

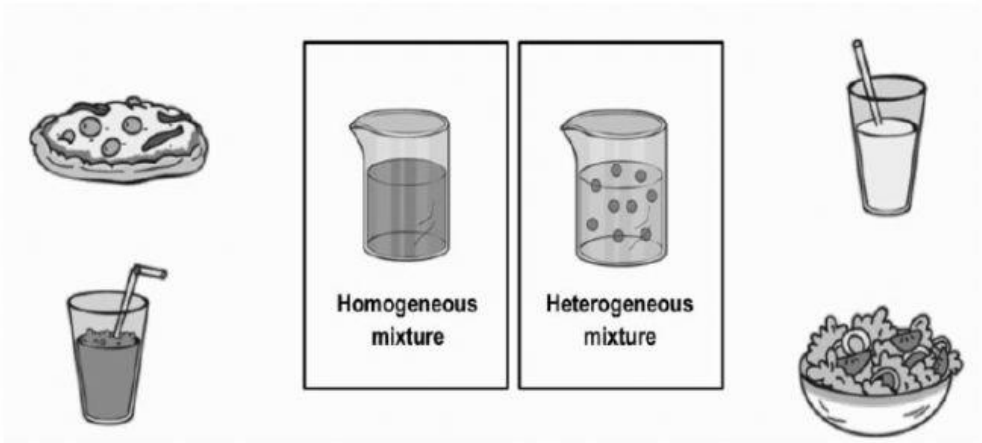

LIVEWORKSHEETS

5.Write can or can't

In an homogeneous mixture we _____see the substances separately

In an heterogeneous mixture we _____ see the substances separately

6.Write HOMOGENEOUS or HETEROGENEOUS

7.Classify

lemonade

stone

spoon

cloud

milk

vapour

SOLID	LIQUID	GAS
_____	_____	_____
_____	_____	_____

LIVEWORKSHEETS

8. Write ***bending***, ***heating*** or ***cooling***.

_____ _____ _____

9. Circle the correct word.

transparent / opaque

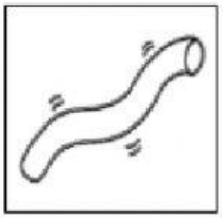

rigid / flexible

hard / soft

10. Write ***solid***, ***liquid*** or ***gas***.

= _____

+

= _____

+

= _____

LIVEWORKSHEETS

11. **Match the pictures where water is in the same state.**

12. **Write the state of water in each picture.**

LIVEWORKSHEETS

13 Match

Glass is	magnetic.
Fabric is	hard.
Metal is	transparent.
Stone is	flexible.
Rubber is	soft.

14. Write *mass* or *volume*.

_____ is the space matter occupies.

_____ is how heavy matter is.

LIVEWORKSHEETS

15. **Complete the sentences using *floats* or *sinks.***

Plastic _____.

Wood _____.

Metal _____.

Stone _____.

16. **Circle the waterproof materials.**

wood	**metal**	**plastic**
cotton	**paper**	**wool**
stone	**glass**	**brick**

17. **Draw the objects that the magnet attracts inside it.**

LIVEWORKSHEETS