Área del Rombo

Completa los huecos para calcular el área de las siguientes figuras, sigue la fórmula indicada:

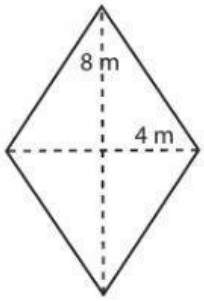

Área = $\frac{\square \quad \square \quad \square}{\square}$

Área = $\frac{\square \quad \square \quad \square}{\square}$

Área = $\frac{\square \quad \square \quad \square}{\square} = \frac{\square}{\square} = \square \; \square^{\square}$

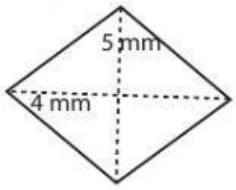

Área = $\frac{\square \quad \square \quad \square}{\square}$

Área = $\frac{\square \quad \square \quad \square}{\square}$

Área = $\frac{\square \quad \square \quad \square}{\square} = \frac{\square}{\square} = \square \; \square^{\square}$

Área = $\frac{\square \quad \square \quad \square}{\square}$

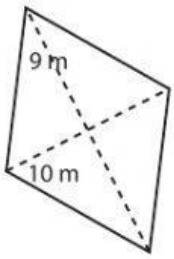

Área = $\frac{\square \quad \square \quad \square}{\square}$

Área = $\frac{\square \quad \square \quad \square}{\square} = \frac{\square}{\square} = \square \; \square^{\square}$

LIVEWORKSHEETS