Yo soy: _____ Hoy es: _____

Escribe los números representados por las regletas

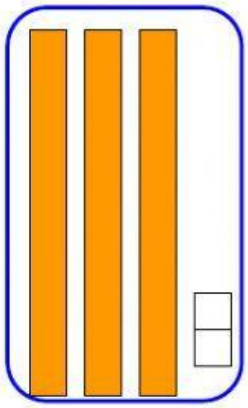

3 dieces y 2
30 + 2 = 32

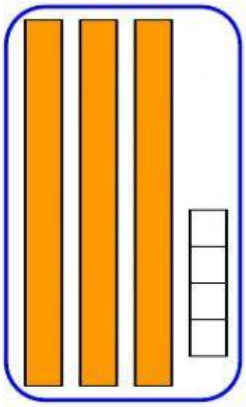

3 dieces y 4
30 + 4 = 34

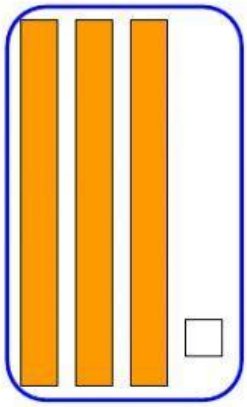

__ dieces y __
__ + __ = __

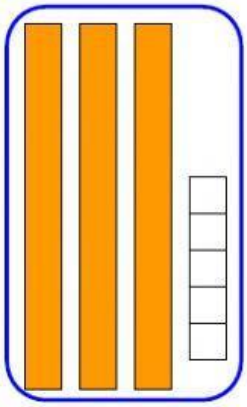

__ dieces y __
__ + __ = __

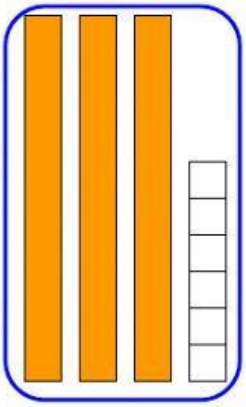

3 dieces y ___
30 + __ = __

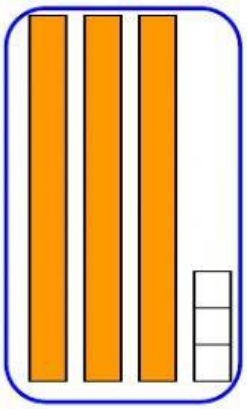

__ ____ y ___
30 + __ = __

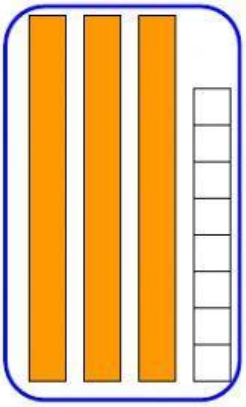

__ ____ y __
__ + __ = __

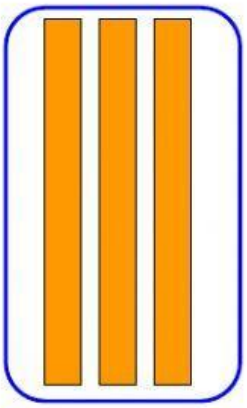

__ ____ y ___
__ + __ = __

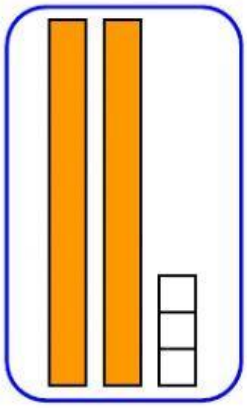

2 ____ y ___
20 + __ = __

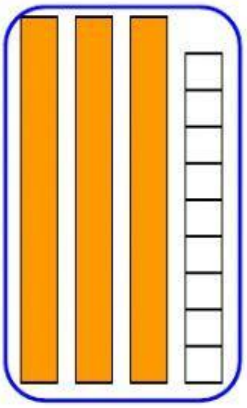

__ ____ y ___
30 + __ = __

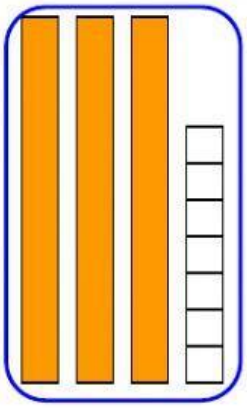

__ ____ y __
__ + __ = __

LIVEWORKSHEETS