Vernier Caliper in Millimeter.

Name:

SPSP ID:

Group:

Watch the video and then solve the below questions:

1. **Read the measurement shown on the vernier caliper in millimeter.**



mm

LIVEWORKSHEETS

2. Read the measurement shown on the vernier caliper in millimeter.



mm

3. Read the measurement shown on the vernier caliper in millimeter. (4-3.2)



mm

LIVEWORKSHEETS