Área y Perímetro de Polígonos
Triángulos, cuadrados y rectángulos

1. Calcula el perímetro de los siguientes polígonos

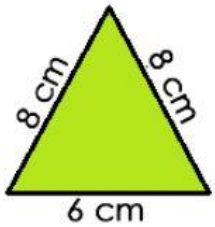

Perímetro: ____ cm

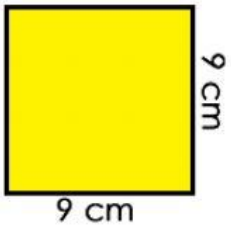

Perímetro: ____ cm

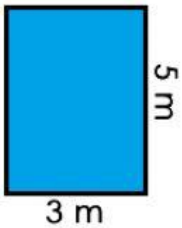

Perímetro: ____ m

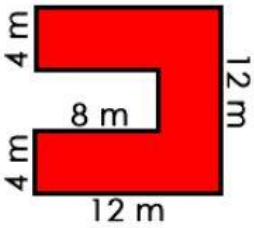

Perímetro: ____ m

2. Calcula el área de los siguientes polígonos

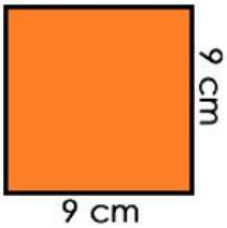

Área: ____ cm^2

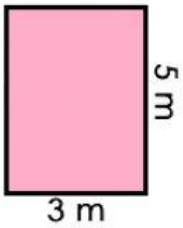

Área: ____ m^2

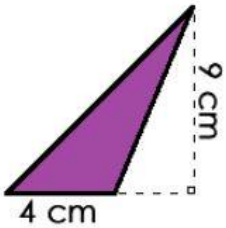

Área: ____ cm^2

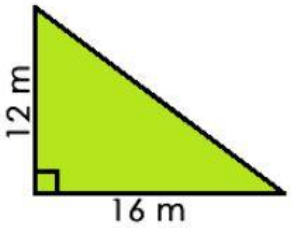

Área: ____ m^2

3. Observa las medidas y calcula el área de cada figura

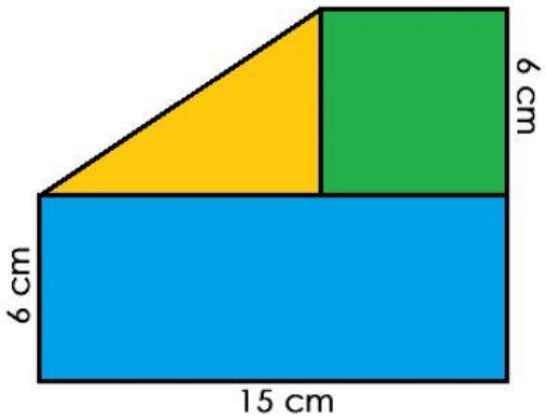

Área del rectángulo: ____ cm^2

Área del cuadrado: ____ cm^2

Área del triángulo: ____ cm^2

Área total de la figura: ____ cm^2

LIVEWORKSHEETS