3D SHAPE PROPERTIES SHEET

Fill in the name, and number of faces, edges and vertices for each shape.

Name: Faces: Edges: Vertices: 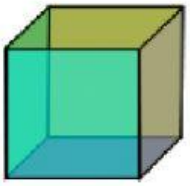	Name: Faces: Edges: Vertices: 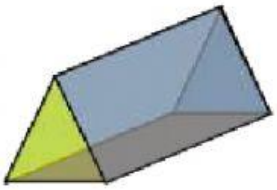
Name: Faces: Edges: Vertices: 	Name: Faces: Edges: Vertices: 
Name: Faces: Edges: Vertices: 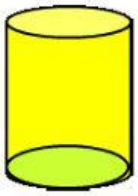	Name: Faces: Edges: Vertices: 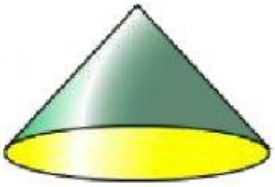
Name: Faces: Edges: Vertices: 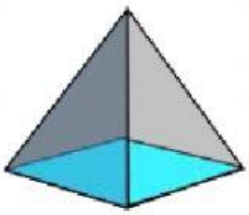	Name: Faces: Edges: Vertices: 

cylind	**square**	**pyramid**	**triangular pyramid**
cube	**sphere**	**triangular**	**prism**

LIVEWORKSHEETS

Three Types of Angles

Label each angle as right, more than, or less than.

1.
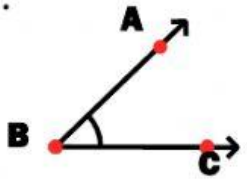

2.
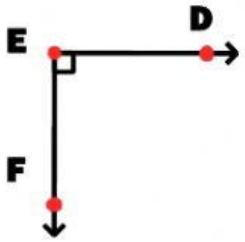

3.
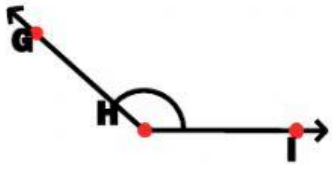

4.
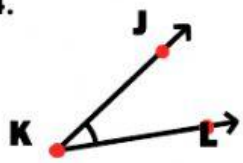

5.
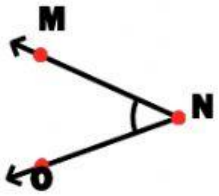

6.

7.
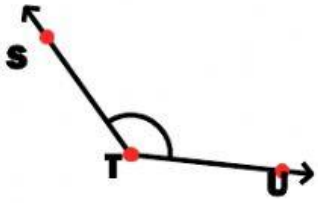

8.
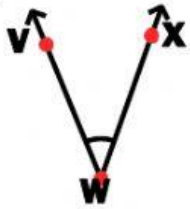

9.
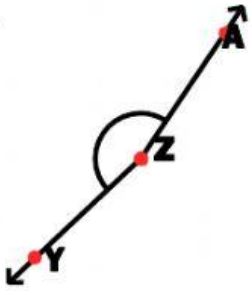

10.
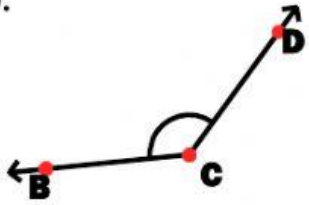

11.
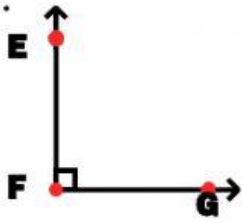

12.
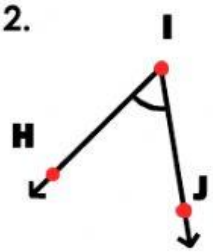

LIVEWORKSHEETS