Name: _____ Date: _____

GLAT (concepts)

1. Write the number that tells how many smiley faces are shown in the set.



Answer: _____

2. Write the largest number that can be made using the digits on the pineapples.

Answer: _____

3. Write the number **8,924** in expanded form.

Answer: _____

4. Write the number **27** as a roman numeral.

Answer: _____

5. Write the correct **ordinal number word** under each picture.

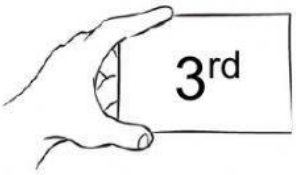

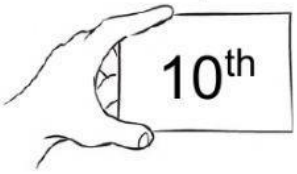

(i) _____ (ii) _____

6. Write the value of the digit '7' in the number **5,720**.

Answer: _____

7. Round the number 73 to the nearest ten.

Answer: _____

8. Round the number 265 to the nearest hundred.

Answer: _____

LIVEWORKSHEETS

9. Write a multiplication sentence for the addition sentence below.

$$3 + 3 + 3 + 3 + 3 = 15$$

Answer: _____ x _____ =. _____

10. Click on the picture that does NOT show a line of symmetry.

11. Write the fraction of the **shaded** part.

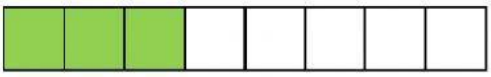

Answer: $\frac{___}{___}$

12. Click on the shape that has more than 4 vertices.

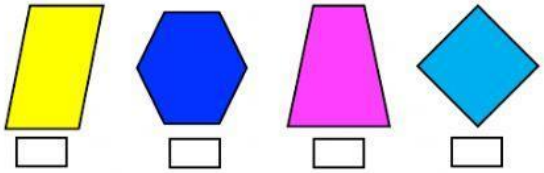

13. Write the time shown on the clocks below.

Answer: ____:____

Answer: ____:____

14. Click on the set of shapes that completes the pattern below.

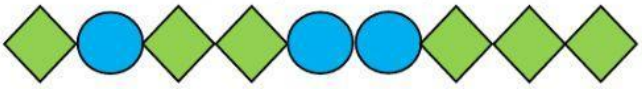

_____

(a) 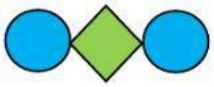

(b) 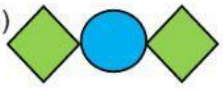

(c)

LIVEWORKSHEETS