Colegio Nourish

2020-2021 **2nd Grade**

May Exam **Math**

Name: _____ **List #** _____

Date: _____ **Teacher: Jacklenis Salazar**

I.- Solve the problems.

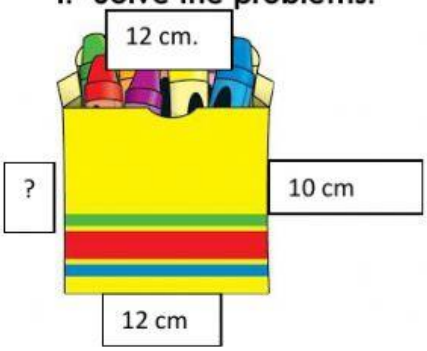

1.What is the distance around the crayon box? Distance around: _____cm.

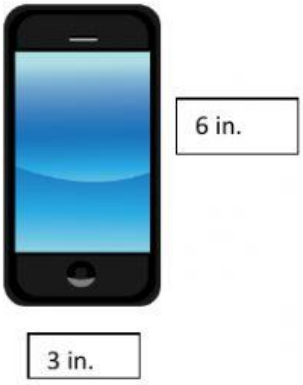

2.What is the distance around the cell phone? Distance around: _____in.

LIVEWORKSHEETS

II. Choose the correct answer.

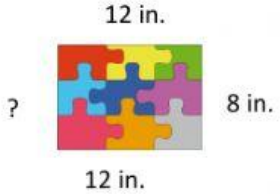

3. The distance around the puzzle is 40 in. Which is the missing measure?

a) 6 in. b) 8 in. c) 12 in.

4. A plant was 10 inches tall. It grew and is now 22 inches tall. How many inches did the plant grow?

a) 10 in. b) 20 in. c)12 in.

5. A notebook measures 15 cm. long. Another notebook measures 25cm. long. What is the total length of both notebooks?

a) 25 cm. b) 40 cm. c) 18 cm.

6. Jomar´s stick is 19 cm. long. He breaks the stick into two pieces. One piece is 7 cm. How long is the other piece?

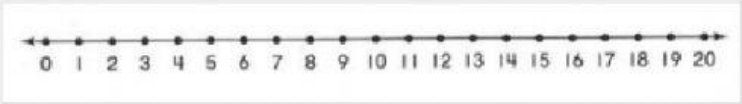

a) 12 cm. b) 5 cm. c)10 cm.

III. Drag and drop. (7-10)

Picture graph | Line plot | Bar graph | Tally chart



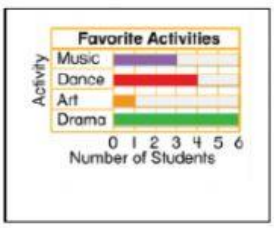

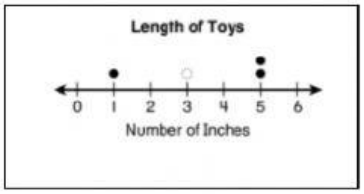

LIVEWORKSHEETS

IV. Choose the correct answer. (11- 15)

Which lengths are missing on the line plot? Choose all that apply.

Yarn Color	Length (in.)
Green	9
Purple	5
Brown	7
Orange	4



a)5 b)4 c) 7

Snake Lengths in Inches			
10	12	10	12
13	11	12	14

Title: Snake Lengths

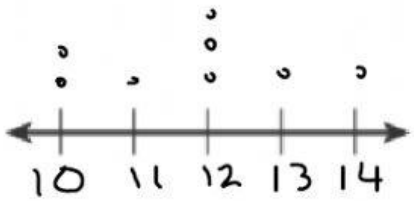

Label: Number of Inches

What is the length of the longest snake?

a) 10 in. b)11 in. c) 14 in.

What is the length of the shortest snake?

a) 10 in. b) 12 in. c)13 in.

What is the most common snake length?

a) 11 in. b)12 in. c)14 in.

LIVEWORKSHEETS

V. Drag and drop. Use the tally chart to complete the picture graph. (16-18)

Favorite Activities	
Puzzles	III
Games	I
Drawing	II

Favorite Activities	
Puzzles	
Games	
Drawing	

VI. Choose the plane shapes. All that apply. (19-20)

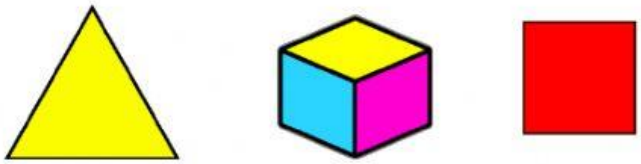

VII. Match each shape to its name. (20-23)



quadrilateral triangle pentagon hexagon

LIVEWORKSHEETS

VIII. Write the sides and vertices of each shape. (24-30)

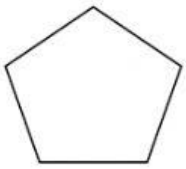

Sides: _____

Vertices:_____

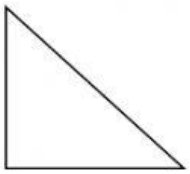

Sides:_____

Vertices:_____



Sides:_____

Vertices:_____

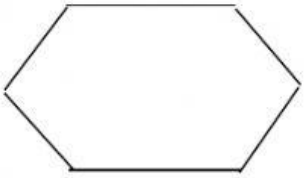

Sides: _____

Vertices: _____

LIVEWORKSHEETS