Al Ezzah School

Math Pop Quiz 3

Grade 3

Term 3

Learning Outcomes: Partitioning and Shapes

Question 1:

What shape has 3 sides and 3 angles ?

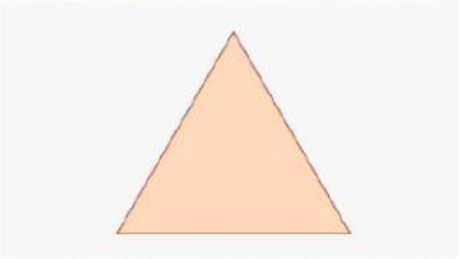

Question 2:

What type of triangle is this?

LIVEWORKSHEETS

Question 3:

What shape is this ?

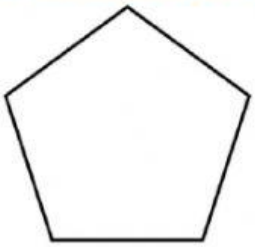

Question 4:

How many sides does a hexagon have ?

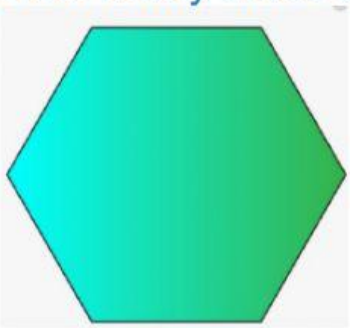

LIVEWORKSHEETS

Question 5:

What shape is this ?

Question 6:

Name this 3D shape ?

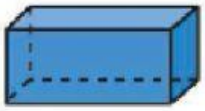

LIVEWORKSHEETS

Question 7:

Name this 3D shape ?

Question 8:

How many pieces is the circle partitioned (cut into) into ?

LIVEWORKSHEETS

Question 9:

What shape is this ?

Question 10:

How many right angles does a rectangle have ?

LIVEWORKSHEETS