DIYAFAH INTERNATIONAL SCHOOL L.L.C
مدرسة ضيافة الدولية ذ.م.م
NURSERY حضانة

Name: _____ **Year 4:** ___ **Term 3 Maths quiz: Intermediate and higher** _____ / 70

Question 1: Number and place value

1. Complete the pattern.

a) 14; 18; _____; _____; _____; 34; _____; 42

b) 25; 50 ; _____; 100 _____ ; 150 ; 175 ; _____ 225 ; _____

c) _____; 350 ; 450 ;_____ ; 650 ; 750 ; _____; _____

d) 1500 ; 1600 ; _____; 1800 ; 1900 ; _____ ;_____; 2200 _____ (16x1/2= 8 Marks)

2. Find the number represented by the place value blocks.

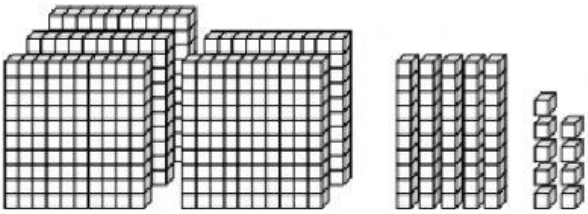

= _____

(2 Marks)

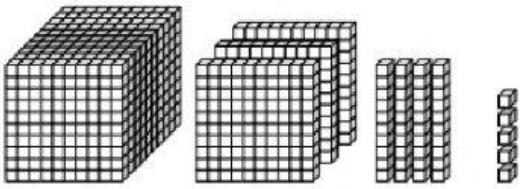

= _____

3. Write the number represented by the expanded form:

a. 300 + 60 +5 = _____ b. 900 + 80 + 6= _____

c. 7000+500 + 20+4= _____ d. 10 + 4000+200+4= _____ (4 Marks)

4. Write the number that is written in words:

a. Two hundred and fifty-five = _____

b. Nine hundred and ninety-nine = _____

c. Seven thousand and fifty-three = _____ (3 Marks)

LIVEWORKSHEETS

5. Write the following numbers in words:

a. 245 = _____

b. 804 = _____

c. 2648 = _____ (3 Marks)

6. Compare the number by writing **< ; > or =**

a. 244 _____ 254

b. 9944 _____ 9299

c. 5250 _____5000+200+50+5 (3 Marks)

7. Rouding: Complete the following table by rounding the numbers to the nearest 10,100 and 1000.

Make sure you look at the example given. (6 Marks)

Number:	Nearest 10	Nearest 100	Nearest 1000
1562	1560	1600	2000
2549			
5648			

Question 2: Adding and subtracting dirhams.

1. Addition

a.

AED _____

b.

AED _____

(2 Marks)

LIVEWORKSHEETS

2. Subtraction.

You received 200AED for Eid. Work out the change if you consider buying the following items. Use the example to complete the working out.

a. 200 AED -

= 190 AED change.

b. 200 AED -

= _____ AED change.

c. 200 AED -

= _____ AED change (3 marks)

Question 3: Division

1. Divide the apples into 5 bowls.



Remember: Divide means to SHARE. If we have 15 apples and we need to share it amongst 5 friends, how many apples will each friend get? 15÷5=The answer is 3 Apples.

Use the following method to find the answers:

57 ÷ 3 = 19

How many times does 3 go into 5?

It goes into 5 once and has a remainder of 2.

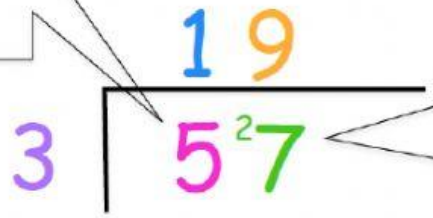

How many times does 3 go into 27?

It goes into 27 nine times and has no remainder.

LIVEWORKSHEETS

36 ÷ 3 =	60 ÷ 4 =	126 ÷ 3 =
48 ÷ 4 =	96 ÷ 3 =	104 ÷ 4 =

(6 marks)

Question 4: 2D shapes

Fill in the missing words/numbers in the table below.

Shape	Name	Number of Sides	Number of corners
	Triangle	3	3
	Square		

(17 Marks)

LIVEWORKSHEETS

Question 5: Triangles

Choose the correct name for each triangle by looking at the sides. (There is 2 of each type)

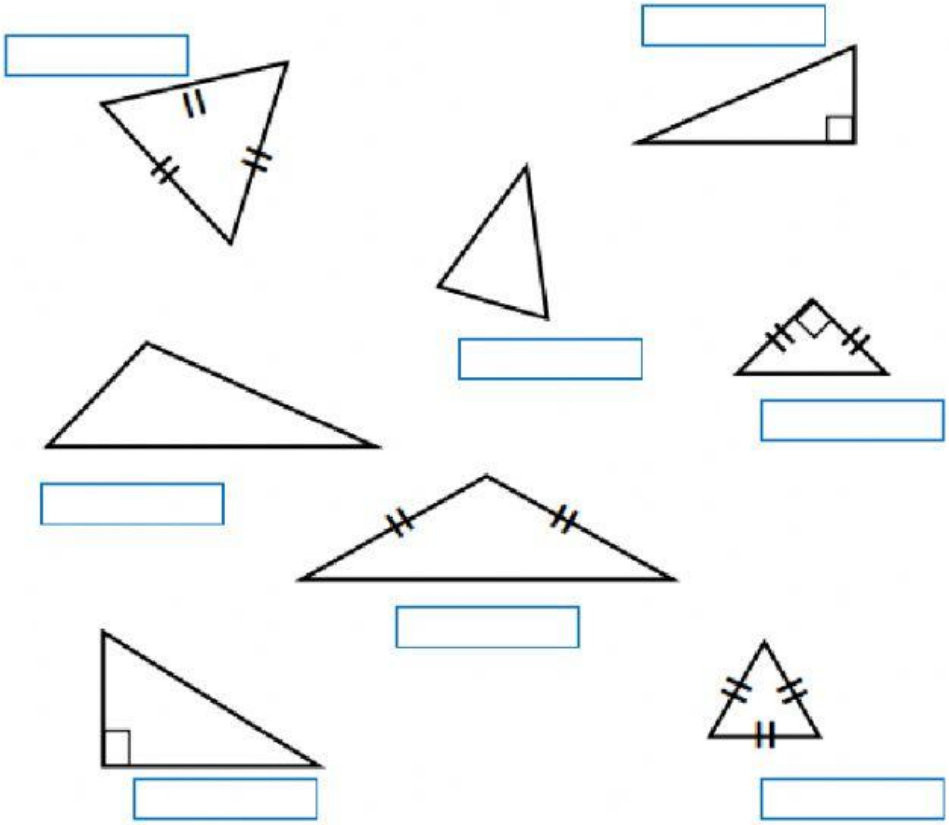

(8 Marks)

Question 6: Quadrilaterals

Choose the correct name for each quadrilateral by reading the properties of each shape.

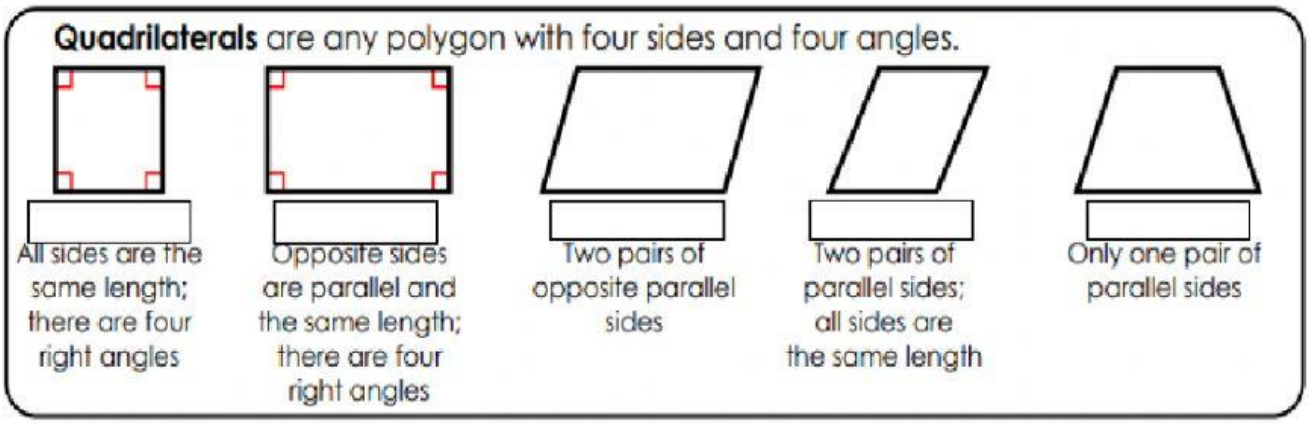

(5 Marks)

LIVEWORKSHEETS