Colegio Buonarroti
Educación Básica - Bachillerato Unificado

Tema: Números decimales en la semirrecta numérica

NOMBRE: _____

FECHA: _____

1. Escribe los números representados por letras en la semirrecta numérica.

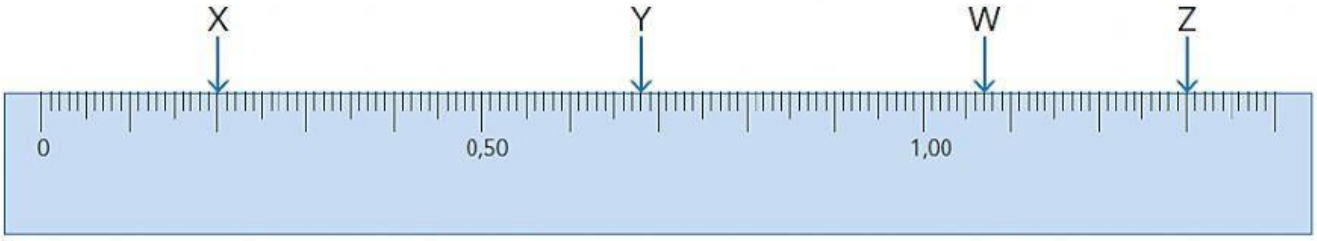

W = ____ X = ____ Y = ____ Z = ____

2. Ubica los siguientes números en la semirrecta numérica.

a. 4,36 4,52 4,28 4,45

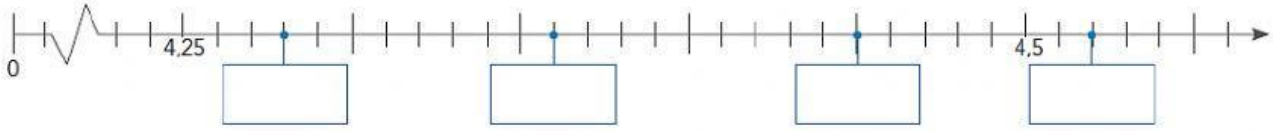

b. 9,11 9,13 9,123 9,118

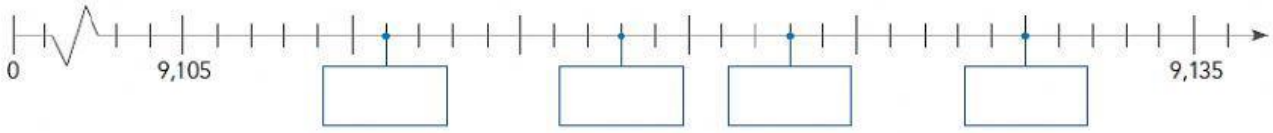

3. Completa con los términos faltantes la semirrecta numérica.

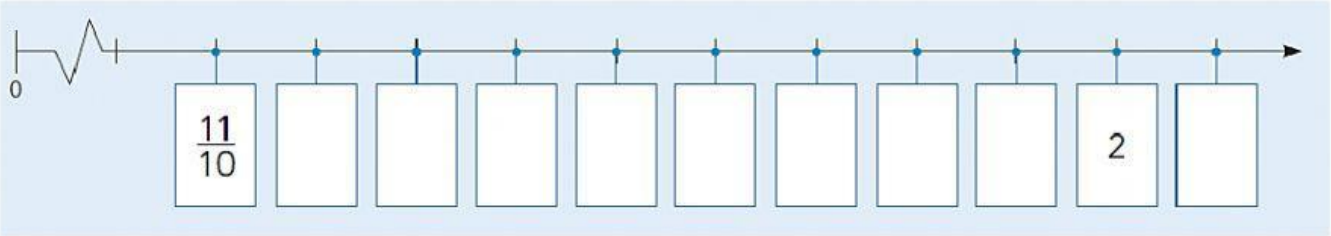

LIVEWORKSHEETS