NÚMEROS NEGATIVOS EN LA RECTA NUMÉRICA

Desarrolla las siguientes actividades:

a) Completa la recta numérica

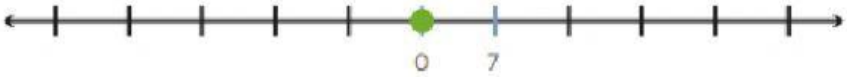

b) Qué número representa el punto azul en la recta numérica:

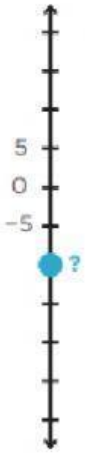

c) Qué número representa el punto azul en la recta numérica:

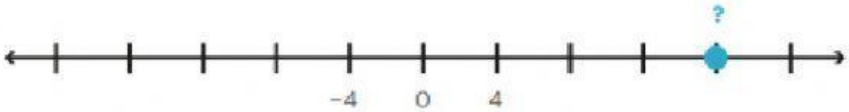

d) Completa la recta numérica

e) Qué número representa el punto azul en la recta numérica:

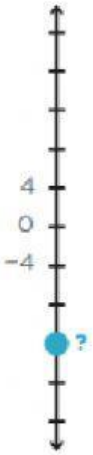

f) Qué número representa el punto azul en la recta numérica:

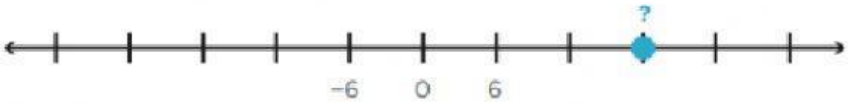

g) Completa la recta numérica

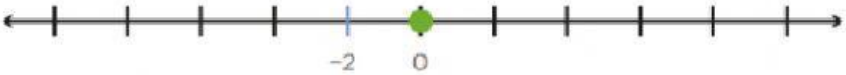

LIVEWORKSHEETS