ESCUELA SAN JOSÉ
Recoleta
Aprendiendo y mejorando.

Fracciones y números mixtos

Actividad 1: Escribe en el recuadro de la derecha, el número mixto y fracción impropia que está representada en cada una de las siguientes cuadrículas:

		Número Mixto	Fracción Impropia
a)			
b)			
c)			

LIVEWORKSHEETS

Actividad 2: Transforma de fracción impropia a número mixto.

$$\frac{15}{4} = \frac{\quad}{\quad}$$

$$\frac{68}{9} = \frac{\quad}{\quad}$$

$$\frac{53}{6} = \frac{\quad}{\quad}$$

$$\frac{75}{4} = \frac{\quad}{\quad}$$

$$\frac{42}{5} = \frac{\quad}{\quad}$$

$$\frac{85}{7} = \frac{\quad}{\quad}$$

$$\frac{19}{2} = \frac{\quad}{\quad}$$

$$\frac{23}{3} = \frac{\quad}{\quad}$$

$$\frac{32}{6} = \frac{\quad}{\quad}$$

$$\frac{62}{8} = \frac{\quad}{\quad}$$

LIVEWORKSHEETS

Actividad 3: Transforma de número mixto a fracción impropia

$3\frac{1}{4} = \frac{\quad}{\quad}$

$6\frac{2}{4} = \frac{\quad}{\quad}$

$2\frac{5}{6} = \frac{\quad}{\quad}$

$7\frac{1}{8} = \frac{\quad}{\quad}$

$1\frac{3}{7} = \frac{\quad}{\quad}$

$1\frac{4}{7} = \frac{\quad}{\quad}$

$8\frac{1}{3} = \frac{\quad}{\quad}$

$2\frac{4}{5} = \frac{\quad}{\quad}$

$5\frac{2}{5} = \frac{\quad}{\quad}$

$3\frac{6}{9} = \frac{\quad}{\quad}$

LIVEWORKSHEETS