Name:_____

Repeated Addition

Match the statement to the correct set.



2 sets of
5 bananas
5+5=10



3 sets of
3 bananas
3+3+3=9



3 sets of
2 bananas
2+2+2=6



4 sets of
3 bananas
3+3+3+3=12

LIVEWORKSHEETS

Drag and drop the statement to match its picture

2 sets of 4 flowers
4+4=8

3 sets of 2 flowers
2+2+2=6

4 sets of 2 flowers
2+2+2+2=8

3 sets of 3 flowers
3+3+3=9

2 sets of 3 flowers
3+3=6











LIVEWORKSHEETS