**ASINI PRĀTU!**

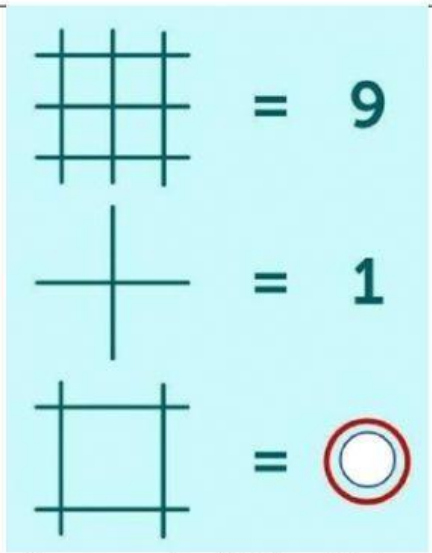

1 = 5

2 = 25

3 = 325

4 = 4325

5 = ☐

Kuram bērnam piepildīs glāzi ar ūdeni?




Kāds skaitlis jāraksta pēdējā lauciņā?

| | | |
|---|---|---|
| 1 | 2 | 3 |
| 4 | 5 | 6 |
| 7 | 8 | 9 |
| 27 | 38 | ☐ |

Kurā glāzē bija visvairāk ūdens?

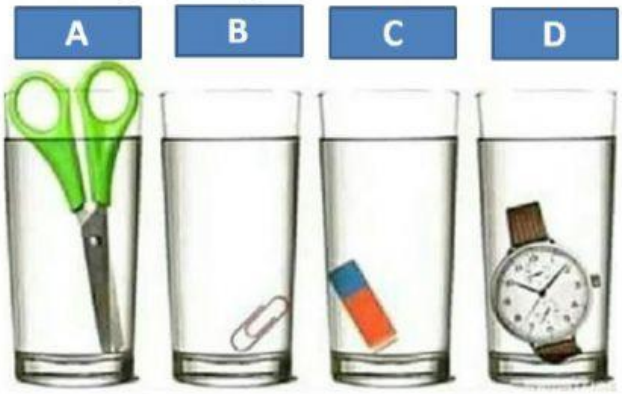


LIVEWORKSHEETS

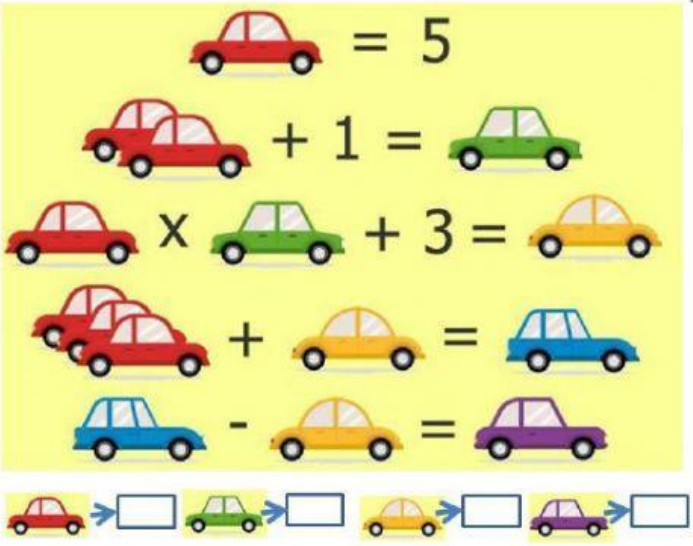


Cik zīmuļu un cik sniegavīru jāuzliek uz pēdējiem svariem?

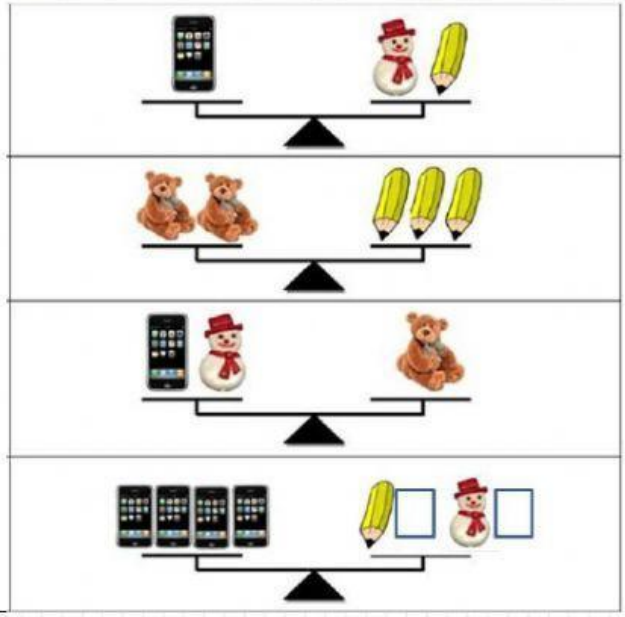

Atzīmē, kuri metamie kauliņi ir izlocīti no dotās sagataves?

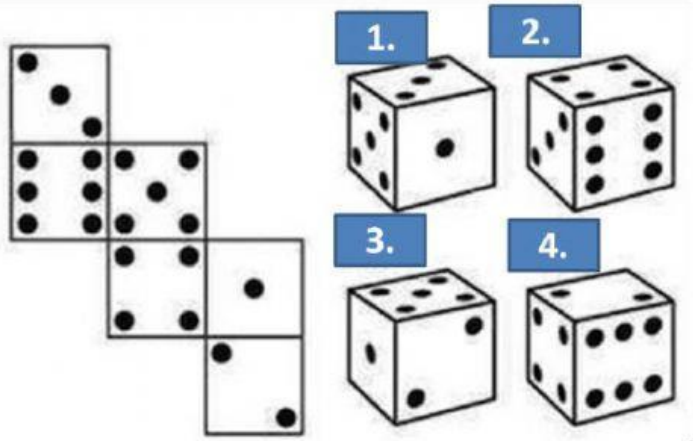


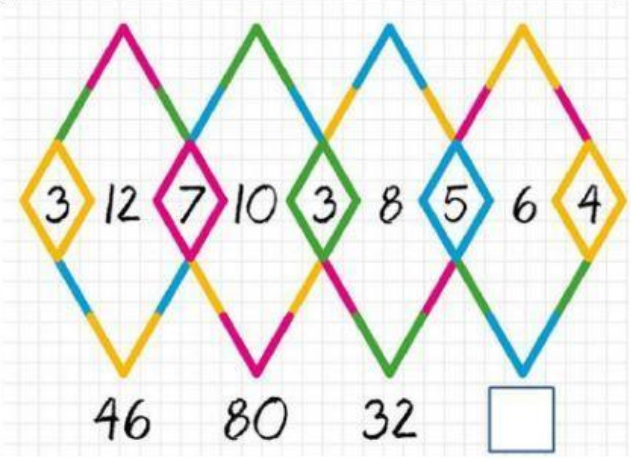


Kurš gabaliņš derēs?

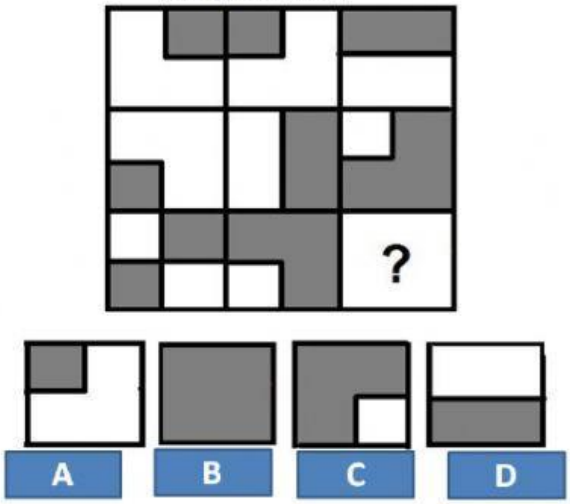


Ieraksti aplīšos ciparus no 1 – 9 tā, lai visu uz trijstūra virsotnēm esošo ciparu summa būtu trijstūrī ierakstītais skaitlis. Katru ciparu raksti tikai vienu reizi!

LIVEWORKSHEETS