19 写出除法算式。

2.4.1 进行基本除法。 (TP 1)

1

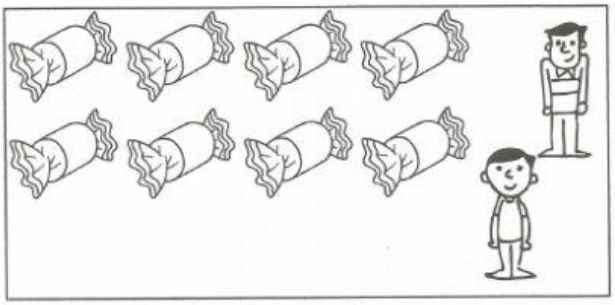

8 颗糖果分给 2 个小孩。

□ ÷ □ = □

2



18 颗玻璃弹珠分别装在 3 个瓶子。

□ ÷ □ = □

3

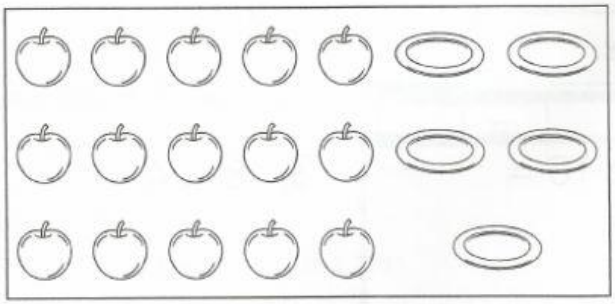

15 个苹果平分放在 5 个盘里。

□ ÷ □ = □

20 看数轴填除法算式。

2.4.1 进行基本除法。 (TP 1)

1

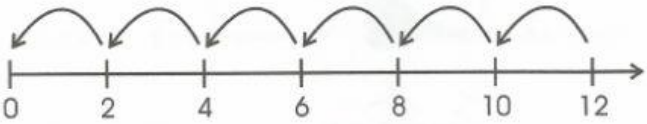

□ ÷ □ = □

2

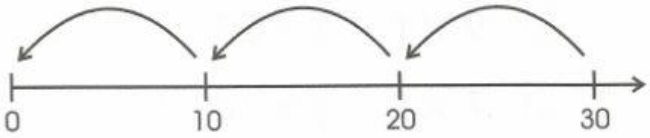

□ ÷ □ = □

3

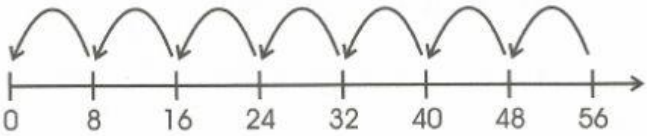

□ ÷ □ = □

学习表现：

19 2.4.1 ~ ( ) 尚未掌握 ( ) 有待改进 ( ) 基本掌握 ( ) 满意 ( ) 良好 ( ) 优良

20 2.4.1 ~ ( ) 尚未掌握 ( ) 有待改进 ( ) 基本掌握 ( ) 满意 ( ) 良好 ( ) 优良

LIVEWORKSHEETS