Name:

Date: Tuesday, May 11, 2021

Subject: Mathematics

1. Write **hot** or **cold** for the picture below.

2. Read the thermometer and write the temperature.

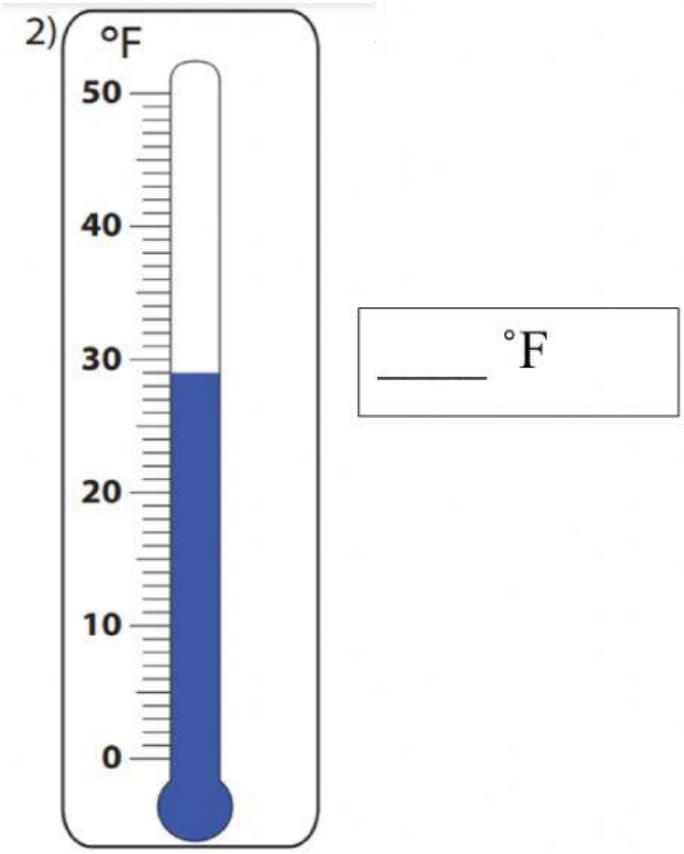

LIVEWORKSHEETS

3. I do not like when my food is hot or cold. I like when it is _____.

a) warm

b) cold

c) brown

4.



The ball is _____ the car.

heavier than

lighter than

as heavy as

5. Which object is the heaviest?

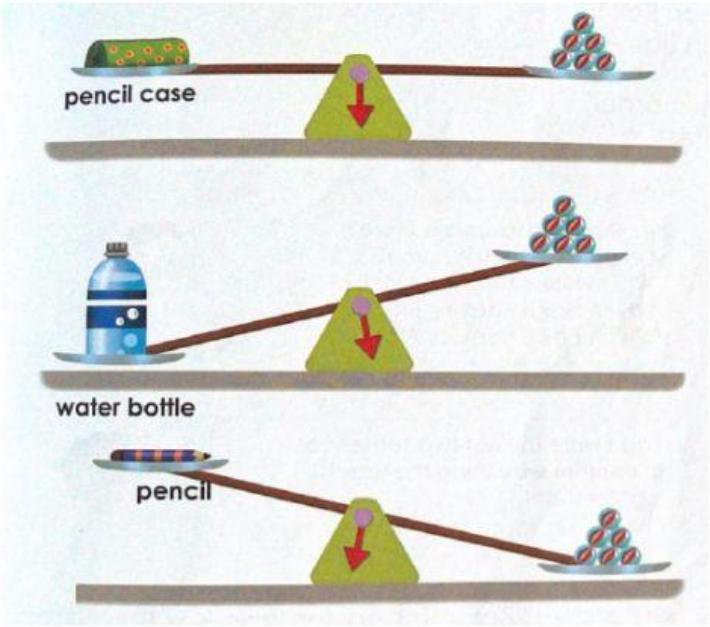

LIVEWORKSHEETS

6.

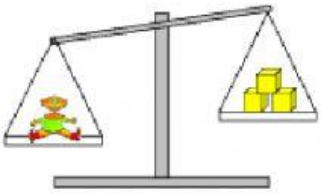

The toy is _____ 3 units.

heavier than

lighter than

as heavy as

7. Which picture shows 3 x 5?



8.

2 x 8 =

9.

3 x 7 =

10.

4 x 11 =

LIVEWORKSHEETS