Berrikusi eragiketak

KENKETAK PAPER BATEAN EGIN ETA GERO OSATU JARDUERAK

1. Zenbat pieza daude? Jarri zenbakiak eta batu.(zenbaki handiena goian)

127 + 342

349 + 607

535 + 276

579 – 308

952 – 127

730 – 248

LIVEWORKSHEETS

2. Paperezko zenbat irudi egin dituzte ikasgela bakoitzean?





3. Irakurri eta kalkulatu falta den gaia.

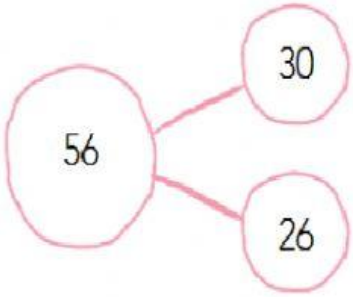

30 + 26 = 56

56 – 30 = 26

56 – 26 = 30

LIVEWORKSHEETS

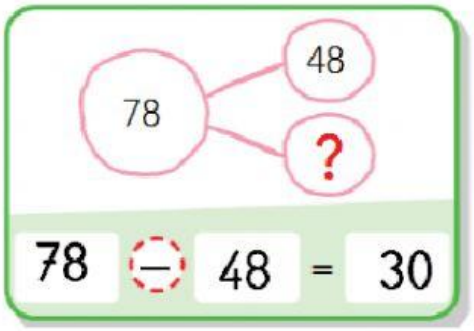

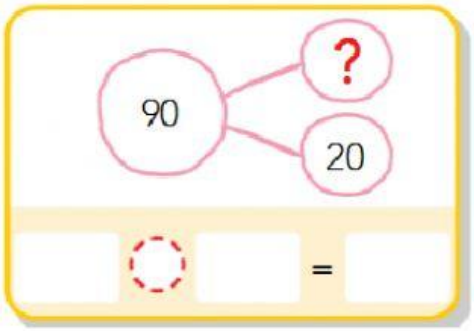

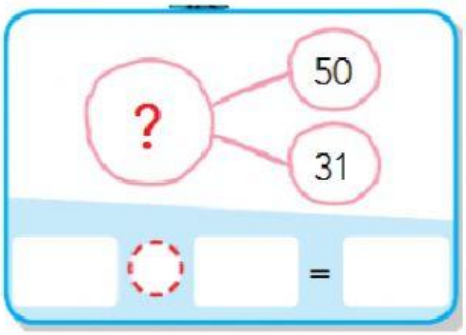

4. Kalkulatu zer zenbaki falta den kasu bakoitzean.

60 + 20 = ☐	☐ + 30 = 90	60 + ☐ = 80
25 + 50 = ☐	☐ + 15 = 45	32 + ☐ = 76
20 + 35 = ☐	☐ + 10 = 60	41 + ☐ = 50

50 – 30 = ☐	☐ – 40 = 10	90 – ☐ = 50
75 – 20 = ☐	☐ – 62 = 30	85 – ☐ = 44
37 – 17 = ☐	☐ – 15 = 45	70 – ☐ = 40

5. Kalkulatu buruz.

Kalkulatu buruz

856 + 100 ☐	482 + 200 ☐	502 + 300 ☐	321 + 400 ☐
454 + 500 ☐	390 + 600 ☐	279 + 700 ☐	149 + 800 ☐

LIVEWORKSHEETS