Name: ..... Class: .....

## Check Your Understanding

**Example 1** Find the length of each line segment or object.

1.

2.

**Example 2**

3.

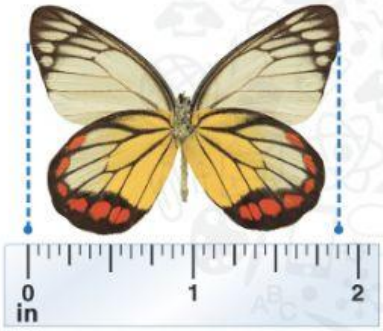


4.

**Examples 3–4** Find the measurement of each segment. Assume that each figure is not drawn to scale.

5. $\overline{CD}$

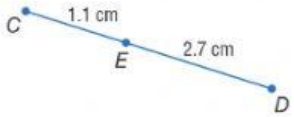


6. $\overline{RS}$

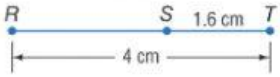


LIVEWORKSHEETS