Name:-

Shapes

Count the sides on each shape and pressthe correct answer below.

5 3 4	3 2 1	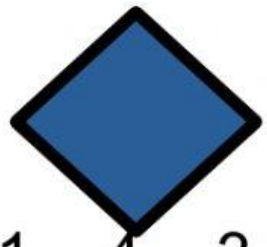 1 4 3
 2 1 6	 1 5 3	 3 2 6
 1 4 8	3 4 1	2 3 8

LIVEWORKSHEETS

Match the object to its shape







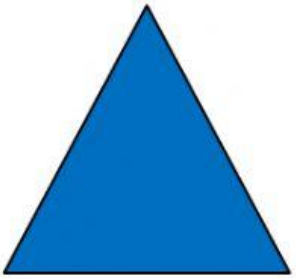

LIVEWORKSHEETS