WRITTEN EXERCISE #03 - T14.1

TOPIC: 14.1 ELEMENTS, COMPOUNDS AND MIXTURES

Answer all questions.

1. Define the following terms:

   a) Atoms

   .....

   .....

   .....

   b) Compounds

   .....

   .....

   .....

   c) Mixture

   .....

   .....

   .....

2. State the methods of purification for the followings:

   a) Atoms : .....

   b) Compounds: .....

   c) Mixture: .....

LIVEWORKSHEETS

3. Identify the following diagrams as either
'Element', 'Compound', 'Mixture of elements, 'Mixture of compounds' ,
'Mixture of elements and compounds'

Diagram	name
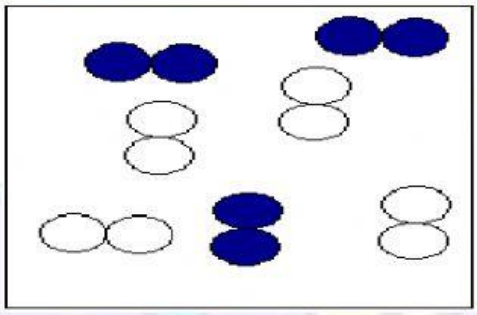	
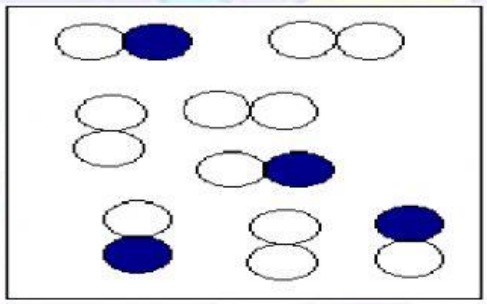	
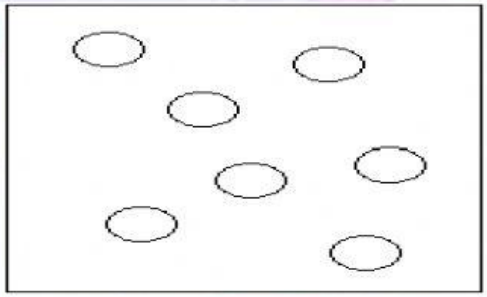	
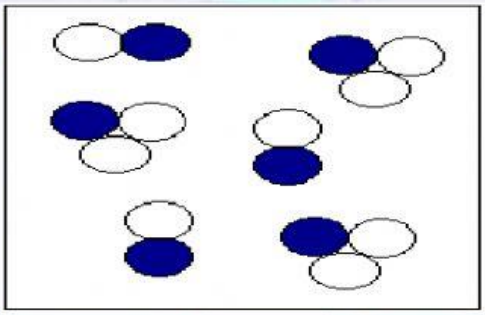	

LIVEWORKSHEETS