NOME:

DATA:

História com Mil Macacos

C	D	U		
CENTENA	DEZENA	UNIDADE		
1	0	0	1 CENTENA	100
	1	0	1 DEZENA	10
		1	1 UNIDADE	1

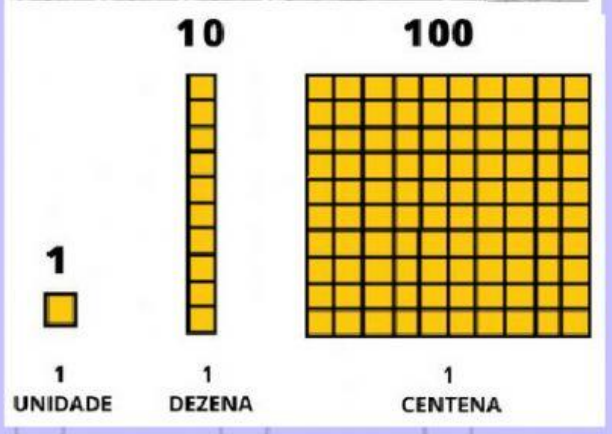

1- Quantos macacos o doutor Quaresma queria pedir ao seu amigo Jeremias?

a) b) c)

Resposta:

2- Quantos macacos o doutor Quaresma recebeu no primeiro dia?

a) b) 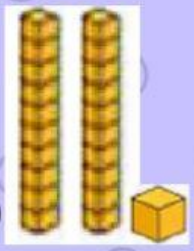 c) 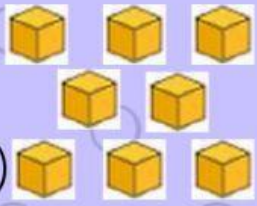

Resposta:

2- Se o doutor Quaresma receber 10 macacos por dia por 10 dias, quantos macacos ele receberia?

a) b)  c)

Resposta:

2- Como representamos mil macacos?

a)  b)  c) 

Resposta:

LIVEWORKSHEETS