Nombre: _____

¿Cuánto mide el perímetro?

Te invito a descubrir la medida perimetral de cada una de las siguientes figuras, utilizando el geoplano, al terminar recuerda anotar el resultado en centímetros (cm).

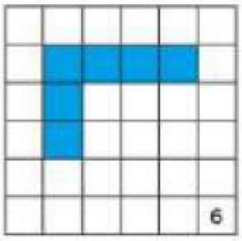

P=

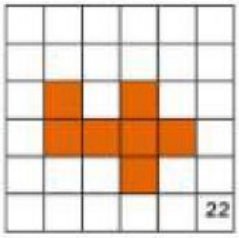

P=



P=



P=



P=

LIVEWORKSHEETS