SAJALISED KÜMNELISED, ÜHELISED

1. Lohista arvud tabelisse!

413 316 246 306 124 433

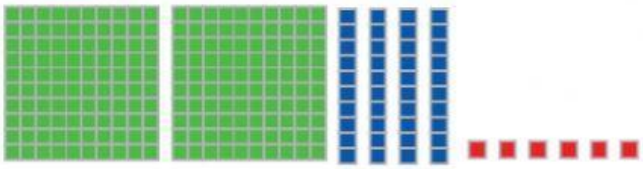	
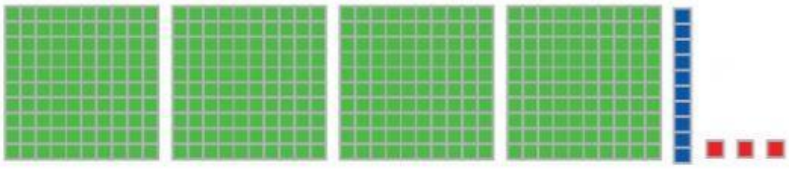	
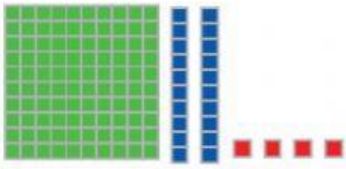	
	

Üle jäid: ..... ja .....

2. Mitu sajalist (S), kümnelist (K) ja ühelist (Ü) on igas arvus?

Arv	S	K	Ü
472			
325			
106			
400			
520			

3. Kirjuta arvud.

Arv	S	K	Ü
	4	3	3
	7	8	1
	2	0	6
	0	5	2
	5	0	0

LIVEWORKSHEETS

4. **Märgi sobivad arvud.**

Sajalisi on 7	725	677	771	154	437	271
Sajalisi on 3	423	431	346	371	363	533
Kümnelisi on 4	241	552	643	324	455	842
Kümnelisi on 0	811	602	540	36	700	203
Ühelisi on 6	236	46	603	886	6	400
Ühelisi on 0	222	357	420	50	130	405

5. **Arvuta.**

400 + 20 + 8 = ...

800 + 30 + 7 = ...

600 + 50 + 6 = ...

700 + 70 + 7 = ...

6. **Kirjuta sajaliste, kümneliste ja üheliste summana.**

453 = [400] + [50] + [3]

271 = [ ] + [ ] + [ ]

168 = [ ] + [ ] + [ ]

335 = [ ] + [ ] + [ ]

LIVEWORKSHEETS