Name: _____ Grade: _____

Mathematics- Multiplication Arrays

Answer the questions using the arrays in each box. (Remember # of rows X # of columns)

1



How many rows are in the array? _____

How many columns are in the array? _____

How many dots are in the array? _____

Write a multiplication fact that is shown by the array.

_____ x _____ = _____

2.



How many rows are in the array? _____

How many columns are in the array? _____

How many dots are in the array? _____

Write a multiplication fact that is shown by the array.

_____ x _____ = _____

3.



How many rows are in the array? _____

How many columns are in the array? _____

How many dots are in the array? _____

Write a multiplication fact that is shown by the array.

_____ x _____ = _____

LIVEWORKSHEETS