Name: _____ Teacher: _____

Note Naming Check #1

1. What is  called? _____
2. What is 𝄞 called? _____
3. What are the names of the spaces?



_____ _____ _____ _____

4. What are the names of the lines?

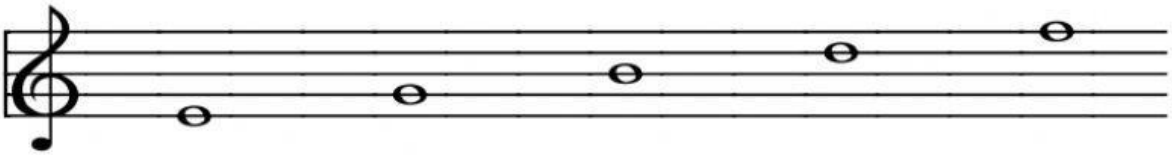

_____ _____ _____ _____ _____

5. Name the notes shown (put answers on lines below the staff).



_____ _____ _____ _____ _____

6. Show where the notes are on the staff (use a whole note).



A D G F B

LIVEWORKSHEETS