NAME_____ DATE_____

FORM 1 TERM III WEEK 3

AREA WORKSHEET

Calculate the area of the figures.

1.



Area= _____cm^2

2.



Area= _____mm^2

3.

Area= _____cm^2

4.

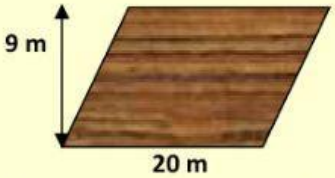

Area= _____m^2

5.

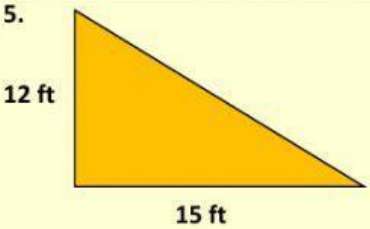

Area= _____ft^2

6.

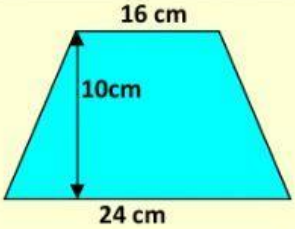

Area= _____cm^2

7.

Area = _____mm^2

8.



Area = _____m^2

9.

Area = _____km^2

Note:

Area of square = L × L

Area of rectangle = L × B

Area of parallelogram = Base × Height

10.

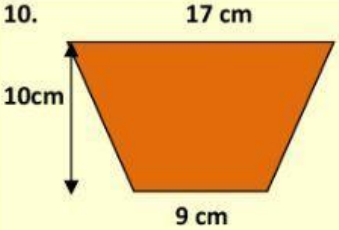

Area = _____cm^2

Note:

Area of triangle = ½ (b × h)

Area of trapezium = **½ (sum // sides) × height**

LIVEWORKSHEETS