Spring Hill International School

Quiz no.7

Scholastic Year 2020/ 2021

Student's Name:

Class & Section: Grade 6

Teacher's Name: Raghda Ziad

Subject: Math / Checkpoint

Test Duration: 10 mins

Date: 27/ April / 2021

Question no.1: **Find the missing angle**

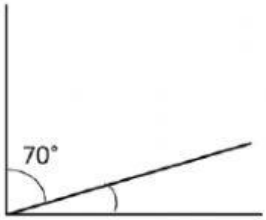



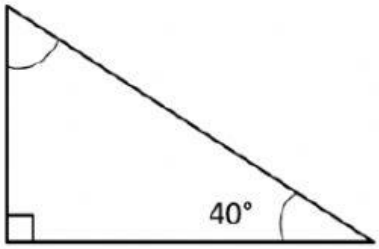

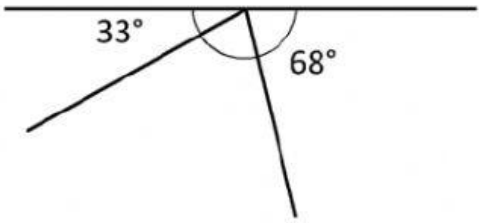

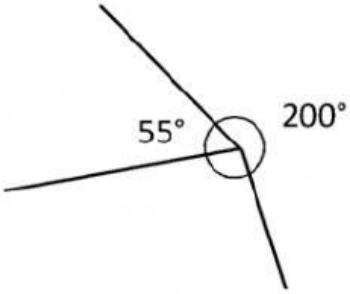

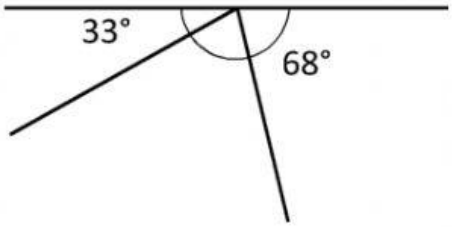

LIVEWORKSHEETS

Question no.2: **Complete the following statements using words from the box**

Transversal	**Parallel**	**Perpendicular**	**Vertically opposite**
360°	**Quadrilateral**	**Triangle**	**Right angle**

a) The angles in a _____ add up to **180°**

b) The angle around a point add up to _____

c) _____ lines create a _____that equals 90°

d) _____ angle are equal

e) The angles in a _____ add up to **360°**

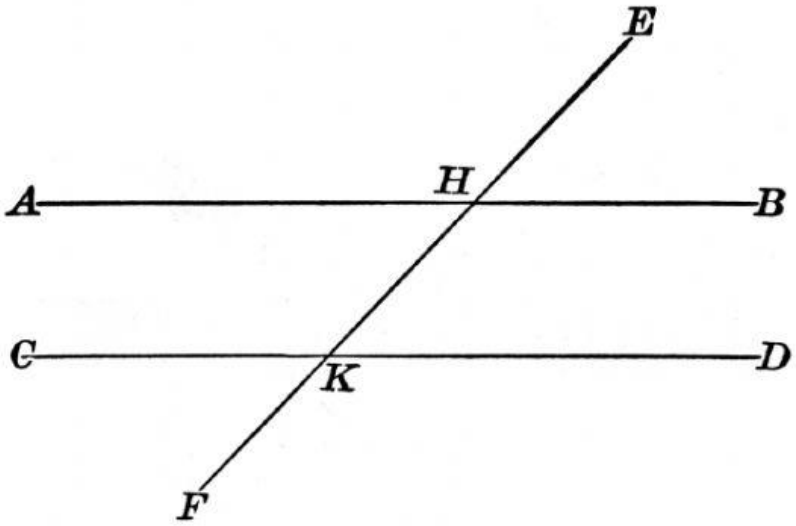

f) AB and CD are _____ lines

g) FE is a _____ line

LIVEWORKSHEETS