Numeri... dopo il 100, ma prima del 1000

1. SCRIVI SOTTO A OGNI ABACO IL NUMERO RAPPRESENTATO, COMPETA COME NELL'ESEMPIO

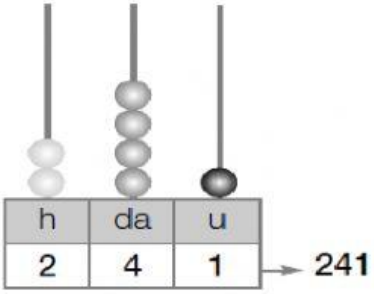

200 + 40 + 1 = 241

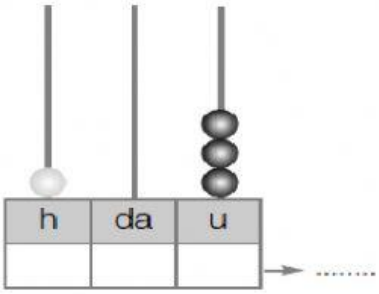

..... = ...

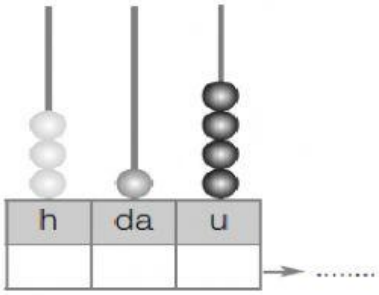

..... = ...

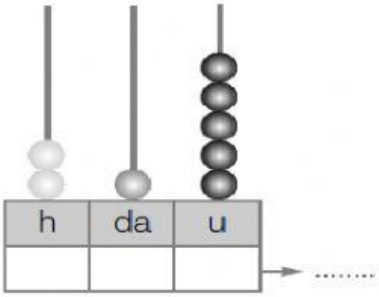

..... = ...

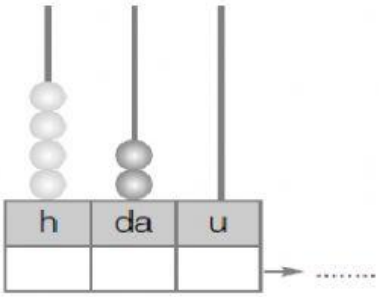

..... = ...

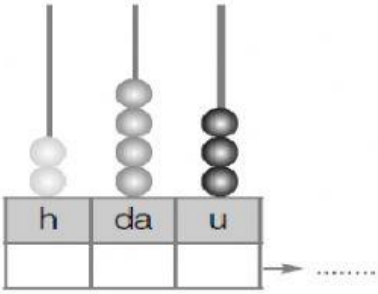

..... = ...

2. REGISTRA LE QUANTITÁ RAPPRESENTATE CON I BLOCCHI LOGICI E COMPLETA, COME NELL'ESEMPIO.



100 + 100 + 10 + 3 = 213



..... + ... + ... + ... = ...



..... + ... + ... = ...



..... + ... + ... + ... = ...

LIVEWORKSHEETS