Unit 17 Electricity and Magnetism Study Guide

Multiple Response

Identify one or more choices that best complete the statement or answer the question.

Series and Parallel Circuits

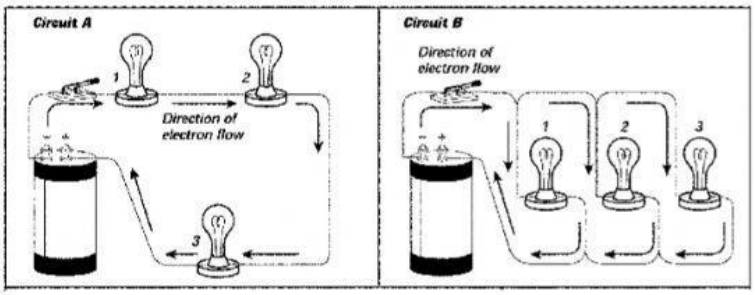

1. Pick all the statements that are true.
   a. Circuit A is a series circuit
   b. Circuit A is a parallel circuit
   c. Circuit B is a series circuit
   d. Circuit B is a parallel circuit

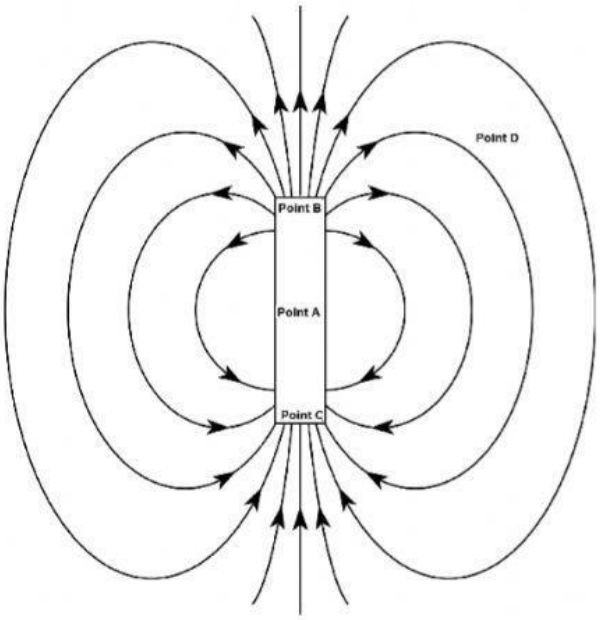

2. At which point or points would the magnetic force be the weakest? Pick all that apply.
   a. Point A
   b. Point B
   c. Point C
   d. Point D

Series and Parallel Circuits

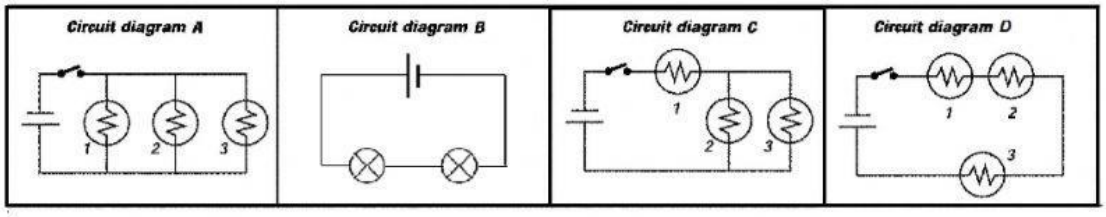

3. Which circuit or circuits are series? Select all that apply.
   a. Circuit A
   b. Circuit B
   c. Circuit C
   d. Circuit D
4. Which circuit or circuits are parallel? Pick all that apply.
   a. Circuit A
   b. Circuit B
   c. Circuit C
   d. Circuit D
5. Which circuit or circuits have a switch? Pick all that apply.
   a. Circuit A
   b. Circuit B
   c. Circuit C
   d. Circuit D

LIVEWORKSHEETS