Year 4 Maths-Term 3-Week 2-Lesson 3
Measurement-MASS

LO: To read scales marked in Kilograms and in grams

Challenge 1

1)

_____ g

2)

_____ kg

3)

_____ g

4)

_____ kg

5)

_____ g

6)

_____ kg

LIVEWORKSHEETS

Challenge 2

1 Write the mass to the nearest 100 g, shown on each scale.

a

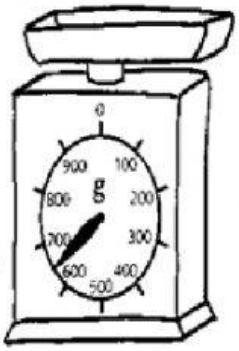

b

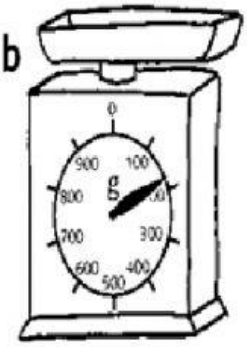

c

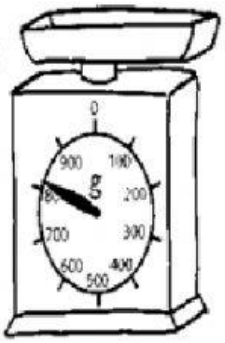

d

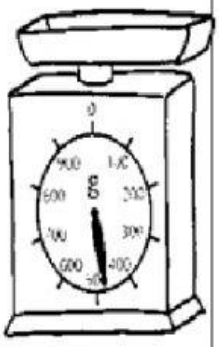

a.	b.	c.	d.

Challenge 3

Fish A has a mass of 750 g. Use the clues to find the mass in grams of these fish.

a Fish B is 200 g lighter than Fish A.

b Fish C is double the mass of Fish B.

c Fish D is 350 g heavier than Fish C.



Fish A: 750 g

Fish B: _____ g

Fish C: _____ g

Fish D: _____ g

LIVEWORKSHEETS