Area and Perimeter (Graded Worksheet)

Find the **area and perimeter** of each geometric shape. Make sure to **show your work** by writing a **number sentence** for each. Do not forget your **units**! **(2 pts each)**

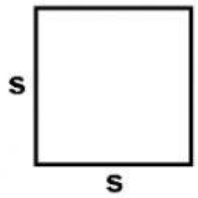 **s = 5.7 m**	**Perimeter:** **Area:**
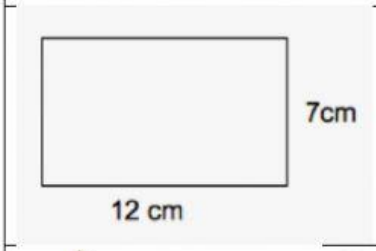	**Perimeter:** **Area:**
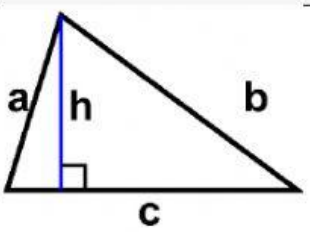 **a = 3.5 ft** **b = 4.7 ft** **c = 4.2 ft** **h = 3 ft**	**Perimeter:** **Area:**
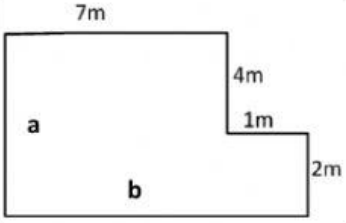	**Length of side a:** **Length of side b:** **Perimeter of whole shape:**
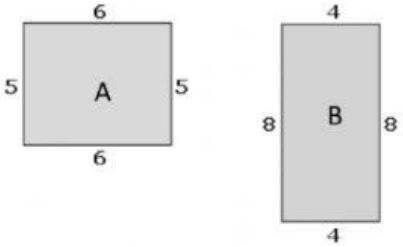	**Which shape has a larger perimeter and area(Figure A or B)? Explain your answer with evidence.**

LIVEWORKSHEETS