Spring Hill International School

Quiz no.6

Scholastic Year 2020/ 2021

Student's Name:

Class & Section: Grade 4

Teacher's Name: Raghda Ziad

Subject: Math / Checkpoint

Test Duration: 10 mins

Date: 20/ April / 2021

Question no.1: **Complete the answer boxes**

Cube	Cylinder	Square-based pyramid
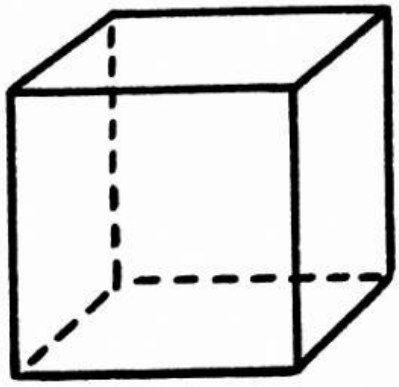		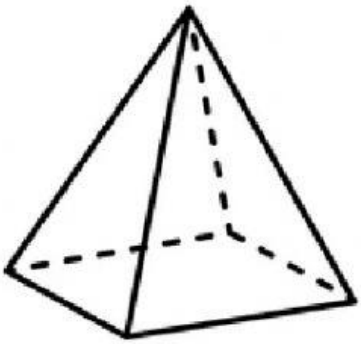
Number of faces	**Number of faces**	**Number of faces**
Number of vertices	**Number of vertices**	**Number of vertices**
Number of edges	**Number of edges**	**Number of edges**

LIVEWORKSHEETS

Question no.2: **Select the correct name for each shape**

a) Pyramid
b) Cone
c) triangle
d) cylinder

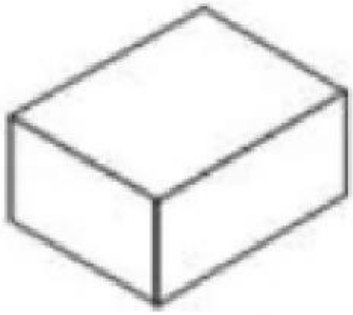

a) Cuboid
b) Cube
c) Cone
d) Triangle prism

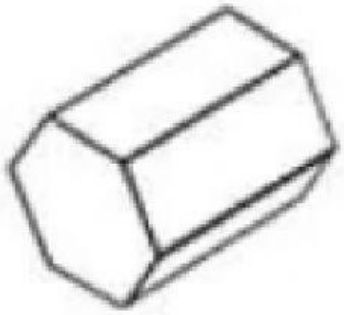

a) Hexagonal based pyramid
b) Hexagon
c) Hexagonal prism
d) Hexahedron

LIVEWORKSHEETS