Pakistan International School, Jeddah
Cambridge Curriculum Section (CCS)

Subject: Mathematics
Grade: 1

Topic: Addition and subtraction number bonds for 10

Q.1 Complete the number sentence.

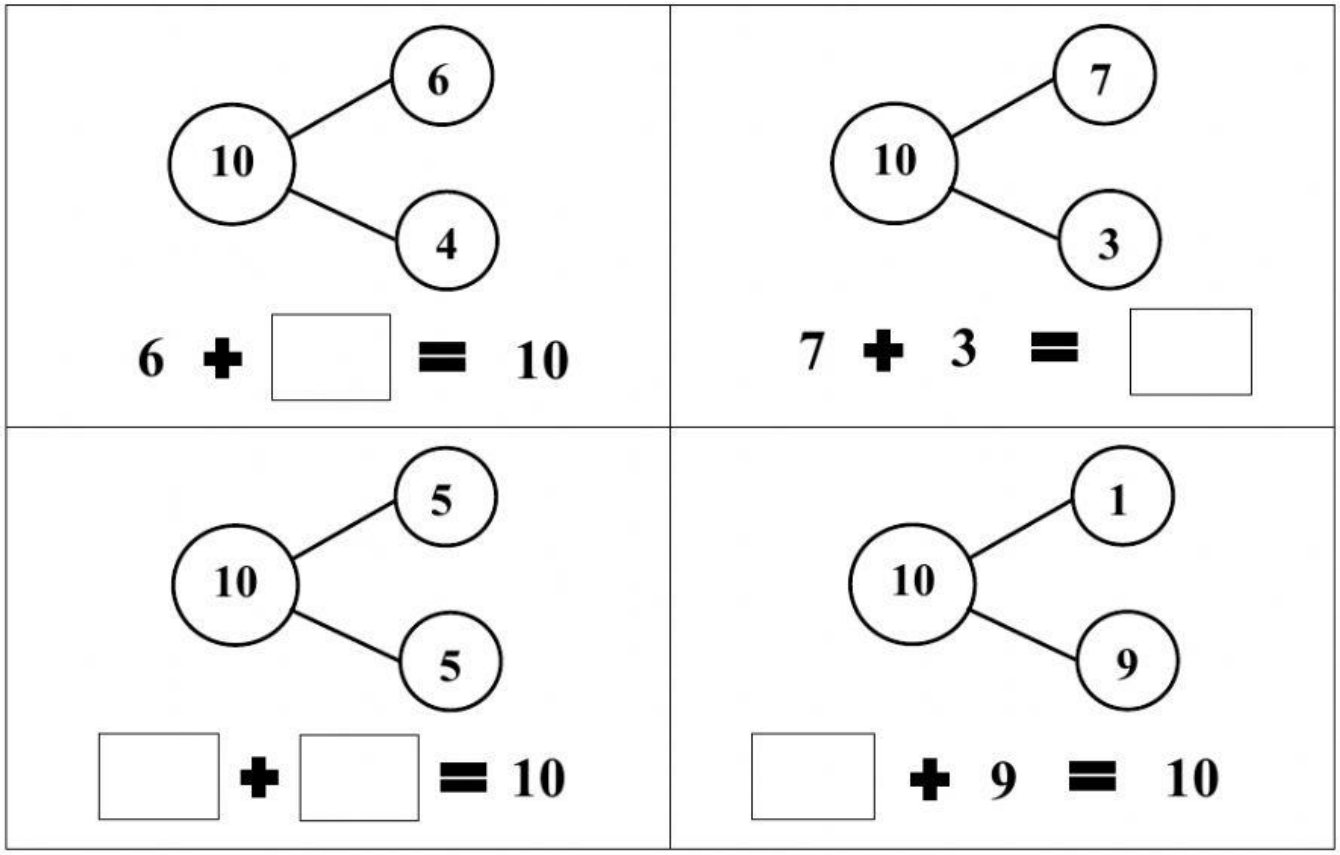

Q.2 Write two addition number sentences for the given number bond.

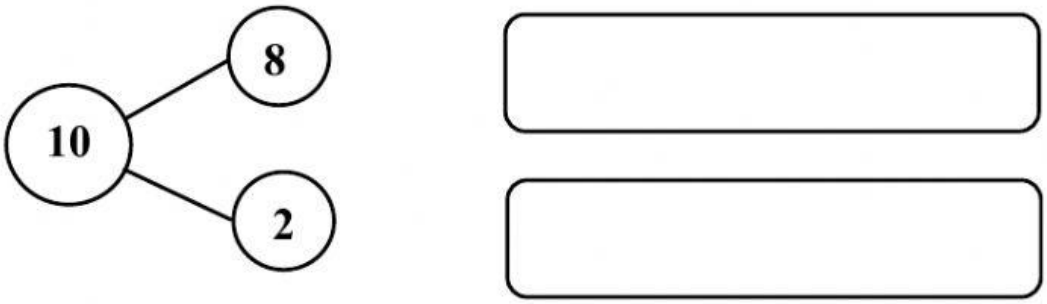

LIVEWORKSHEETS

Q.3 Write two subtraction number sentences for the given number bond.

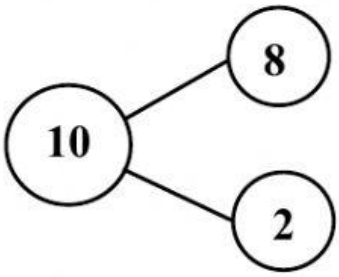

Q.4 Use the same numbers to write another number sentence.

a. 4 + 6 = 10 ☐ + ☐ = 10

b. 3 + 7 = 10 ☐ + ☐ = 10

c. 10 – 9 = 1 10 – ☐ = ☐

d. 10 – 2 = 8 ☐ – 8 = 2

e. 10 – 0 = 10 10 – ☐ = 0

LIVEWORKSHEETS