3D SOLID SHAPES

1. Match

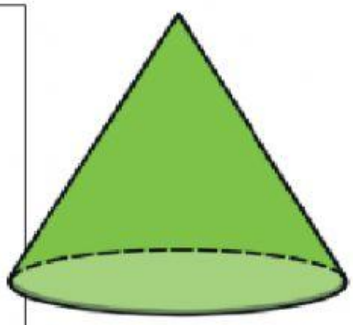

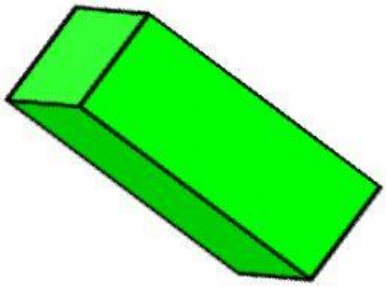

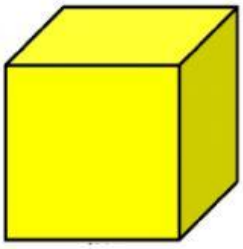

SPHERE

CUBE

PYRAMIDE

CUBOIDE

CYLINDER

CONE

LIVEWORKSHEETS

2. Complete the table

	3D shape	Number of curved surfaces	Number of flat surfaces
a)			
b)			
c)			
d)	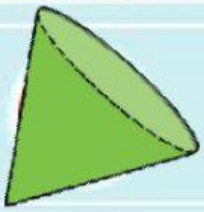		
e)	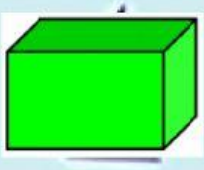		

LIVEWORKSHEETS

3. Drag and complete the sentences

PYRAMIDE

CUBE

CYLINDER

SPHERE

CONE

a. I have 1 curves surface and 2 flat surfaces

b. I only have 1 curved surface

c. I don't have curved surfaces. I have 6 flat surfaces

d. I have 1 curved surface and 1 flat surface

e. I don't have curved surfaces. I have 5 flat surfaces

LIVEWORKSHEETS