What is the mass of the objects?



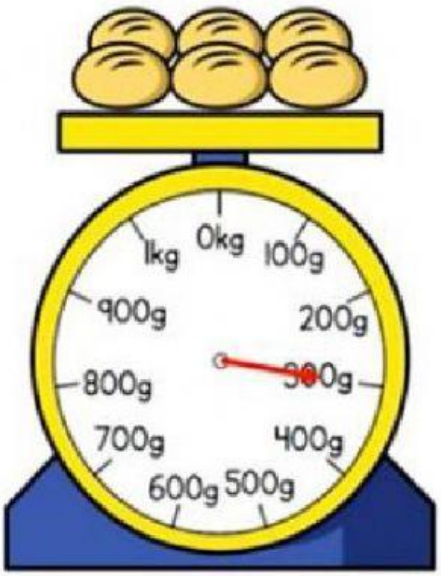

The mass of the grapes is _____ g

The mass of the bread rolls is _____ g

What is the weight of the eggplant?

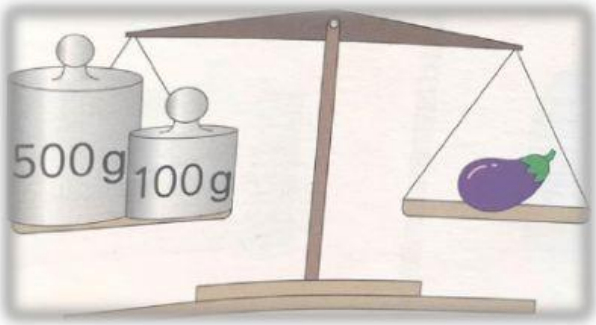

_____g

MS POONAM

LIVEWORKSHEETS

1 Kg = _____g

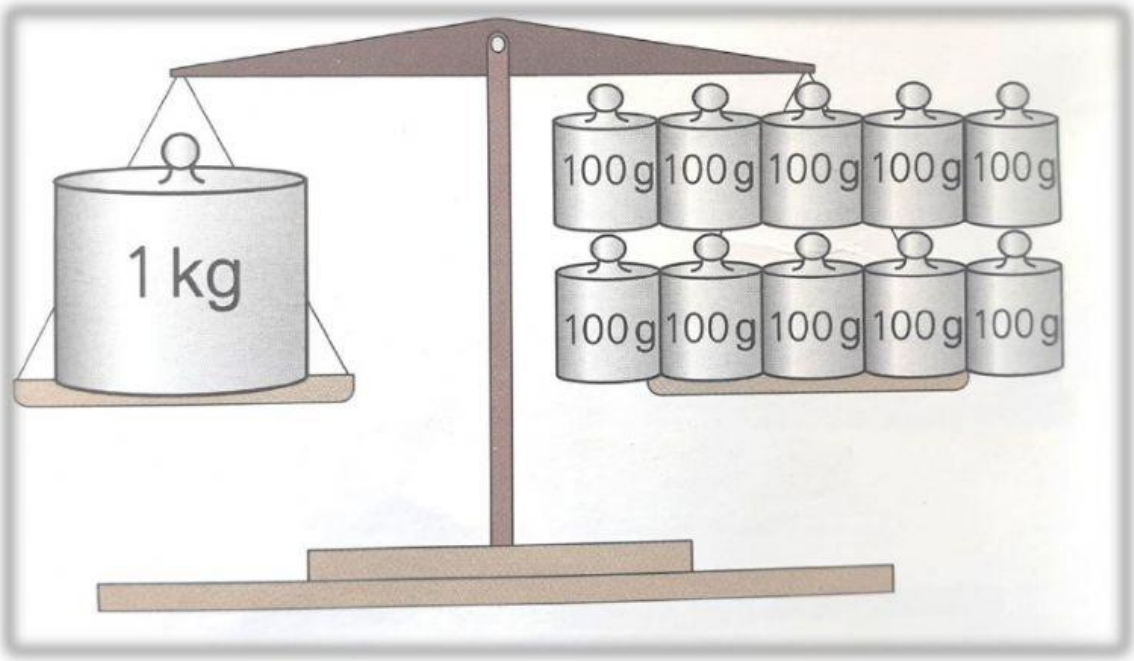

Fill in the blanks

1. Mass is also called _____.
2. 1 kilogram is _____
3. All _____ objects are weighed in Kilograms.
4. All light objects are weighed in _____

MS POONAM

LIVEWORKSHEETS

Write down the correct mass of each item on the scales.

(a)

_____ kg

(b)

_____ kg

(c)

_____ kg

Match the following. Choose the correct weight.

50g

4 kg.

2000 kg.

MS POONAM

LIVEWORKSHEETS