Revision Topic- 12, L 1, 2,3,4,and 6

1- The number line shows 4 wholes. Which number completes the division sentence?

4 ÷ ____ = 8

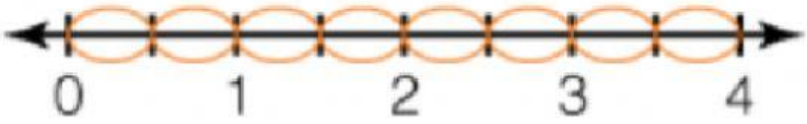

a. ½ b. ¼ c. 1/3 d. 1/5

2- Use the number line model to complete the division equation. Fill the missing boxes?

$\square \div \frac{2}{5} = \square$

a. 4 and 10 b 6 and 8

---

3. Complete each division sentence using models…

A. 5

B. 4

C. 2

$\frac{5}{6} \div \frac{1}{6} = \square$

LIVEWORKSHEETS

4. Find the quotient. Draw a diagram to help.

$$\frac{5}{6} \div 2$$

A.

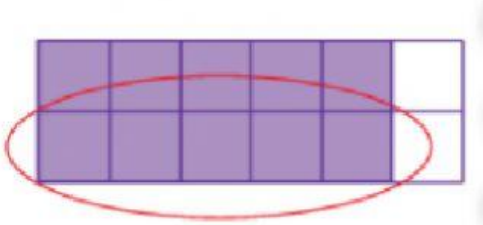

B.

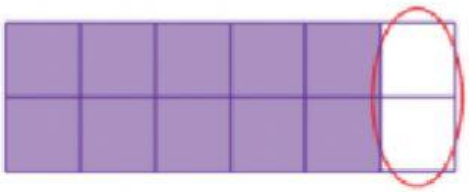

5. Complete the division sentence using the model provided.

$$\frac{2}{3} \div \frac{1}{12} = \square$$

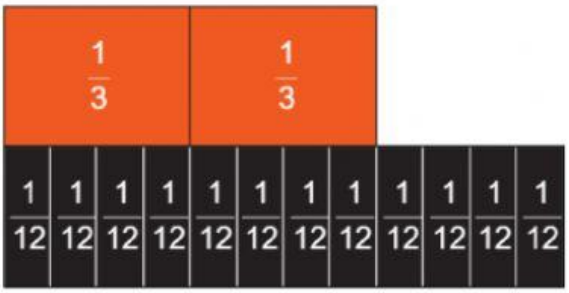

A. 8 B. 10 C. 12

6. Complete the division sentence using the model.



$$\frac{2}{3} \div \frac{1}{6} = \square$$

A. 4 B. 5 C. 6

LIVEWORKSHEETS

7. **Complete each division sentence using models…**

$$\frac{4}{5} \div \frac{1}{10} = \square$$

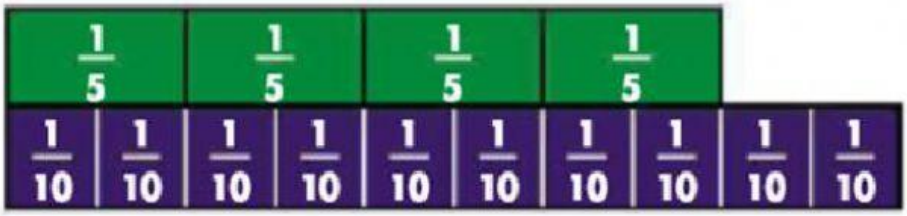

A. 8

B. 9

A. 10

8. Find the quotient: $\frac{8}{10} \div 1\frac{5}{6}$

A. 24/55

B. 21/ 34

C. 12/10

9. The reciprocal of is 1/5 ?

A. 6/1

B. 5/1

C. 3/1

LIVEWORKSHEETS

10- Find the Quotient $5\frac{1}{3} \div 1\frac{1}{3}$. ?

A- 5

B- 8

C- 4

11- what is the quotient of $2\frac{1}{4} \div 1\frac{1}{2}$?

A- $1\frac{1}{2}$

B- $1\frac{5}{9}$

12- Divide. Write in the simplest form.

$$5\frac{1}{2} \div 2$$

A- $3\frac{1}{4}$

B- $2\frac{3}{4}$

LIVEWORKSHEETS