Decimāldaļas
Decimāldaļas, to pieraksts

• Atzīmē burtam atbilstošo skaitli. Iespējamas vairākas atbildes.

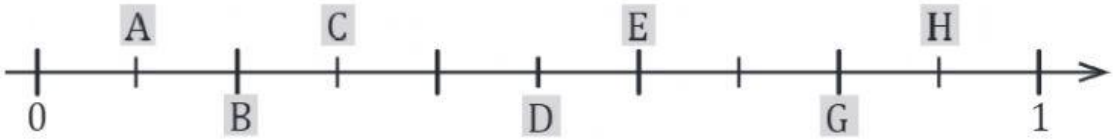

A	B	C	E	H
○ 0,1	○ 0,02	○ $\frac{3}{100}$	○ $\frac{6}{10}$	○ $\frac{9}{100}$
○ 0,01	○ 0,2	○ 0,3	○ 0,6	○ 0,9
○ $\frac{1}{100}$	○ $\frac{2}{10}$	○ 0,03	○ $\frac{3}{5}$	○ 0,09
○ $\frac{1}{10}$	○ $\frac{1}{5}$	○ $\frac{3}{10}$	○ $\frac{6}{100}$	○ $\frac{9}{10}$

● Uzraksti burtiem D un G atbilstošos skaitļus.

D _____ _____ _____ G _____ _____ _____

• Cik liela simta kvadrāta daļa ir izkrāsota? Uzraksti attēlam atbilstošos daļskaitļus un decimāldaļas, skaitļus izvēloties no skaitļu bankas. Iespējamas vairākas atbildes.

a)

_____

d)

_____

g)

_____

b)

_____

e)

_____

c)

f)


SKAITĻU BANKA

$\frac{30}{100}$; 0,3; $\frac{2}{4}$; 0,042; $\frac{3}{10}$; 0,9; $\frac{1}{10}$; 0,30; $\frac{90}{100}$; 0,50; $\frac{42}{10}$; 0,03;
$\frac{9}{10}$; $\frac{1}{2}$; 0,42; $\frac{3}{100}$; $\frac{13}{100}$; 0,25; $\frac{25}{100}$; $\frac{10}{25}$; 0,05; $\frac{50}{100}$;
$\frac{5}{10}$; $\frac{1}{4}$; $\frac{1}{5}$; $\frac{75}{100}$; 0,75; $\frac{3}{4}$; 0,07; $\frac{2}{5}$; 0,09; $\frac{42}{100}$; $\frac{9}{100}$;

LIVEWORKSHEETS