Watch the video

Complete the following statements and number sentences.

1.

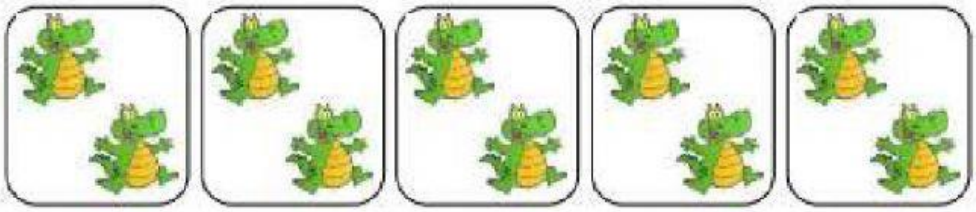

Here are ☐ groups of ☐ dragons. X =

2.



Here are ☐ groups of ☐ ducks. X =

LIVEWORKSHEETS

3.

Here are ☐ groups of ☐ ladybirds. X =

4.



Here are ☐ groups of ☐ monkeys.

X =

LIVEWORKSHEETS

5.



Here are ☐ groups of ☐ bees. X =

6.

Here are ☐ groups of ☐ owls. X =

7.

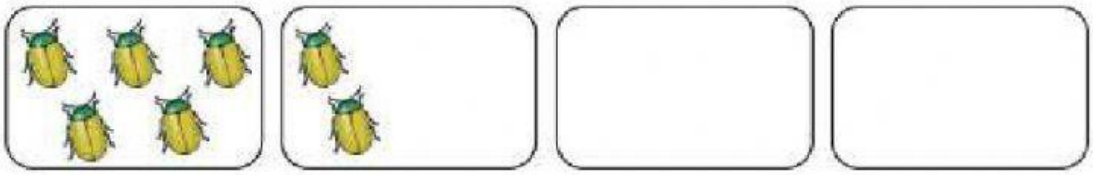

Ann is drawing 4 equal groups of 5.
Please can you complete her drawing. Drag the objects to the boxes.

X =



LIVEWORKSHEETS