Name: _____ Grade: _____

HEALTH SCIENCE BJC REVIEW

1. Complete the correct level of organization of the human body, from the simplest to the most complex?

   _____, _____, _____, _____.

2. The diagram below is found in many Health Clinics across The Bahamas.

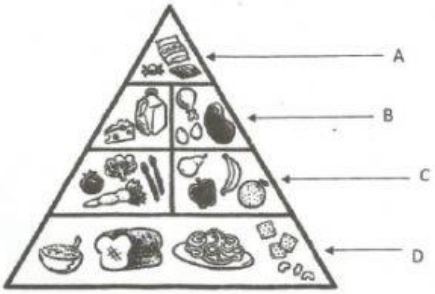

4. An average 15 year old boy needs about 2,800 Calories each day. An average 15 year old girl needs about 400 calories less each day than the average 15 year old boy. About how many Calories would the average 15 year old girl need in five (5) days?
   A. 2,000 calories
   B. 5,200 calories
   C. 12,000 calories
   D. 14,000 calories

5. Which of these actions would be brought about by involuntary muscles?
   A. Dribbling a basketball with left hand
   B. Moving food through your digestive system
   C. Raising your hand to answer question in class
   D. Tying your shoelaces

6. This diagram represents a section of human skin.

Which row is the table below correctly names the parts P, Q, R, and S.

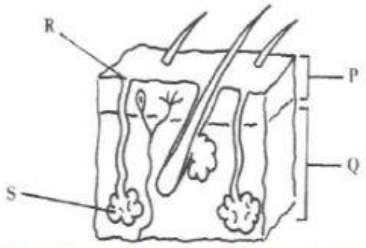

LIVEWORKSHEETS

	P	Q	R	S
A	Dermis	Epidermis	Follicle Pore	Follicle Pore
B	Epidermis	Dermis	Sweat Pore	Sweat gland
C	Dermis	Epidermis	Oil Pore	Oil gland
D	Epidermis	Dermis	Sebaceous Pore	Sebaceous gland

7. The woman on the right has a medical condition. Which row in the table below correct identifies the problem and states the cause of it?

	Medical Problem	**Cause**
A	Anemia	Lack if iron in the diet
B	Goitre	Lack of iodine in the diet
C	Pellagra	Lack of calcium in the diet
D	Scurvy	Lack of thiamine in the diet

8. The diagram shows a boy touching the hot stove top and then immediately pulling his hand away. What do we call this sudden, automation action?

A. Conditioned reflex
B. Voluntary muscle action
C. Voluntary conditioned response
D. Reflex action



9. Which Of These Is A Disease Of The Human Respiratory System?

A. Asthma
B. heartburn
C. scurvy
D. ulcer

LIVEWORKSHEETS