A-6. Sestrojte trojúhelník **ABC**; **a** = 4,5 cm, **b** = 5 cm, **c** = 6,5 cm. (Náčrtek)
a) Změřte **velikosti** vnitřních úhlů úhloměrem a zapište jejich velikost.
b) **Graficky** sečtěte vnitřní úhly α, β, γ.

α = _____

β = _____

γ = _____

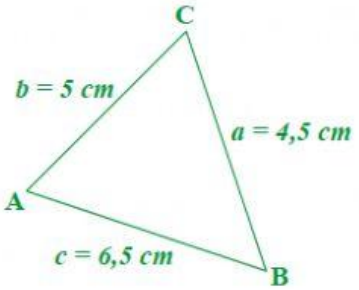

44 50 86

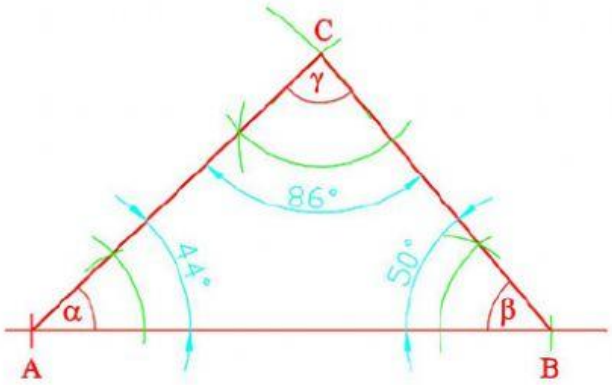

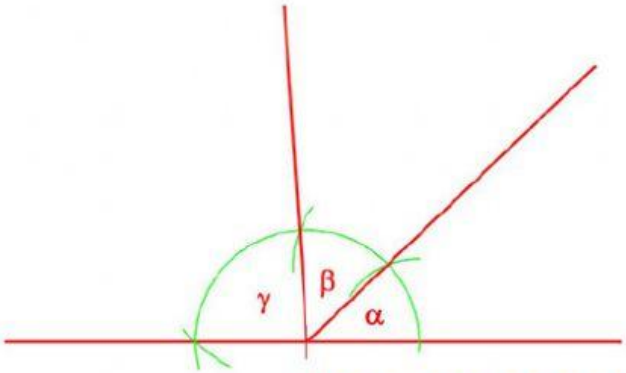

LIVEWORKSHEETS