# المهمة الأدائية لدرس 7-4

اسم الطالب:

اسحب قيمة $x$ أدناه :

| | | | | |
|---|---|---|---|---|
| 16 | 24.2 | 9 | 4.5 | 12 |

قيمة $x$

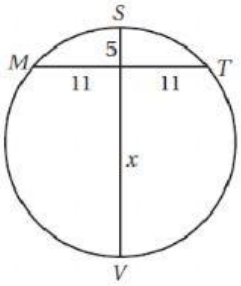


قيمة $x$

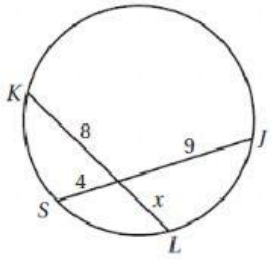


قيمة $x$

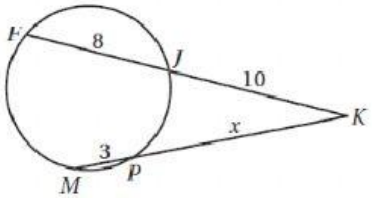


قيمة $x$

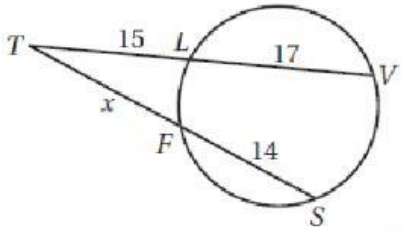


قيمة $x$

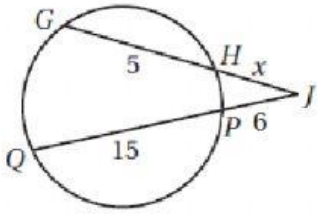


LIVEWORKSHEETS