K intervalu < -3;5> vyber správný obrázek:

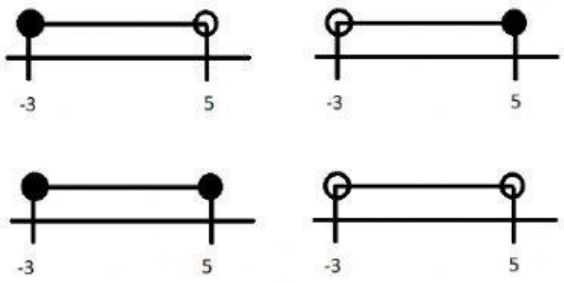

K intervalu < 2;7) vyber správný obrázek:

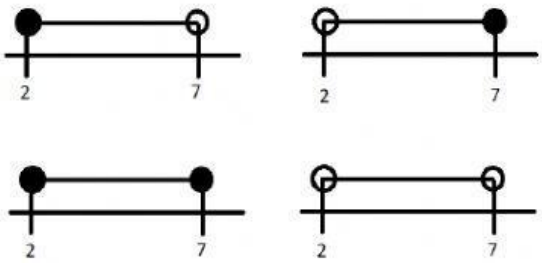

K intervalu (-2;6> vyber správný obrázek:

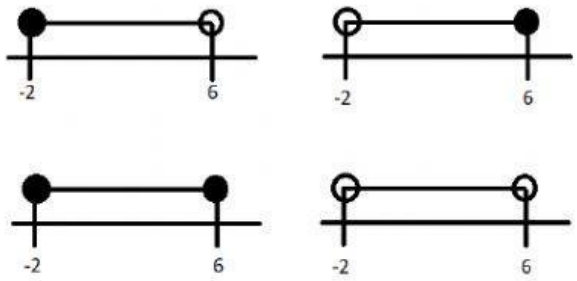

K intervalu (-4;-1) vyber správný obrázek:

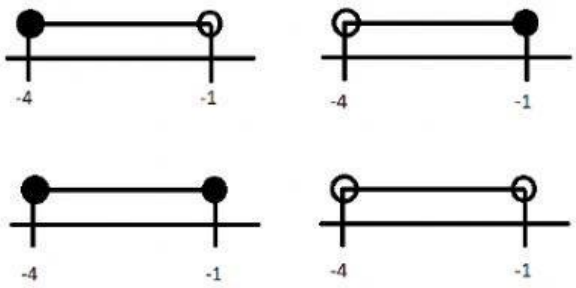

LIVEWORKSHEETS

Vyber správné řešení:

1) $D_f = (-6;-1\rangle \cap (-1;2\rangle =$
   $(-6;2\rangle$
   $\langle -1;2\rangle$
   $(-1;2\rangle$
   $\langle -6;2\rangle$
   $\{\ \}$

2) $D_f = \langle 6;8\rangle \cap (-1;2\rangle =$
   $(-1;8\rangle$
   $\langle -1;8\rangle$
   $\langle 6;8\rangle$
   $\langle 6;2\rangle$
   $\{\ \}$

3) $D_f = (0;4\rangle \cap (-1;2\rangle =$
   $(0;2\rangle$
   $\langle 2;4\rangle$
   $(-1;4\rangle$
   $(0;4\rangle$
   $\{\ \}$

K obrázku vyber správný interval:



$(-6;3)$
$\langle -6;3\rangle$
$\langle -6;3)$
$(-6;3\rangle$

K obrázku vyber správný interval:



$(-8;12)$
$\langle -8;12\rangle$
$\langle -8;12)$
$(-8;12\rangle$

LIVEWORKSHEETS

K obrázku vyber správný interval:



(3;7)
<3;7>
<3;7)
(3;7>

K obrázku vyber správný interval:



(0;21)
<0;21>
<0;21)
(0;21>

LIVEWORKSHEETS