Kvadratická funkce – vrcholový tvar

1. Vyberte graf, který odpovídá předpisu funkce $y = (x - 5)^2$

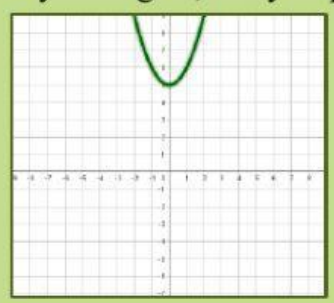
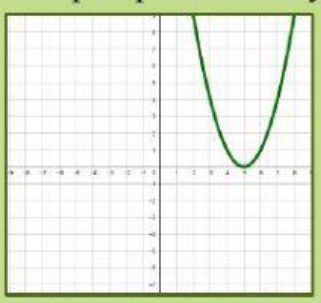
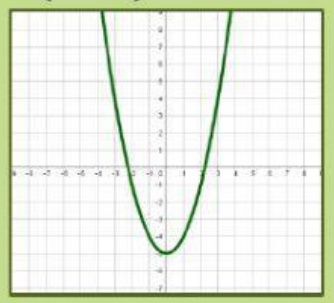
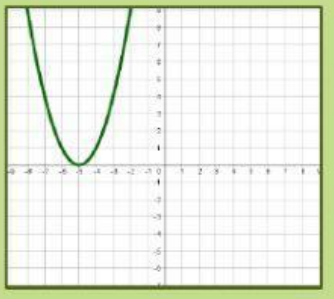

2. Vyberte graf, který odpovídá předpisu funkce $y = x^2 - 3$

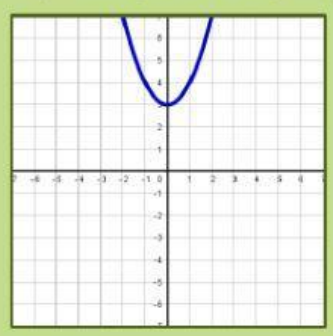
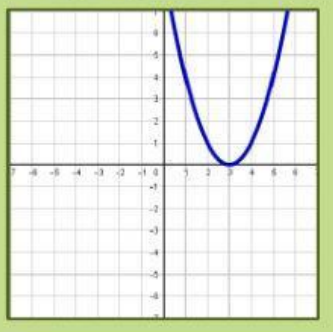
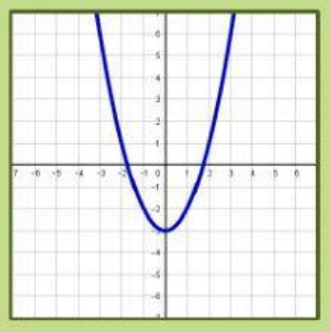
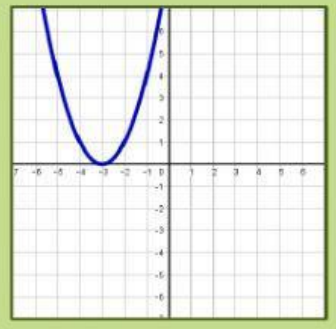

3. Vyberte graf, který odpovídá předpisu funkce $y = (x + 2)^2 - 1$

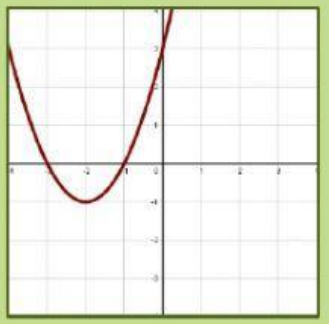
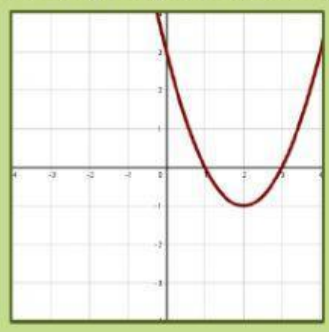
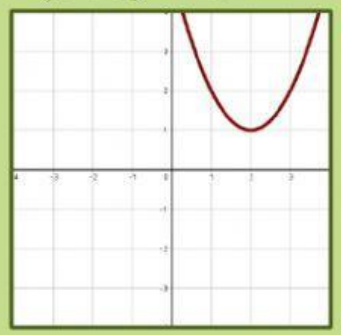
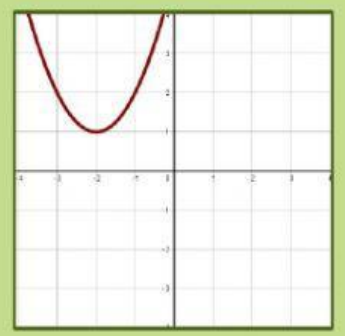

4. Určete, který předpis odpovídá grafu funkce na obrázku

$y = (x - 1)^2 - 4$

$y = (x - 4)^2 - 1$

$y = (x + 1)^2 + 4$

$y = (x + 1)^2 - 4$

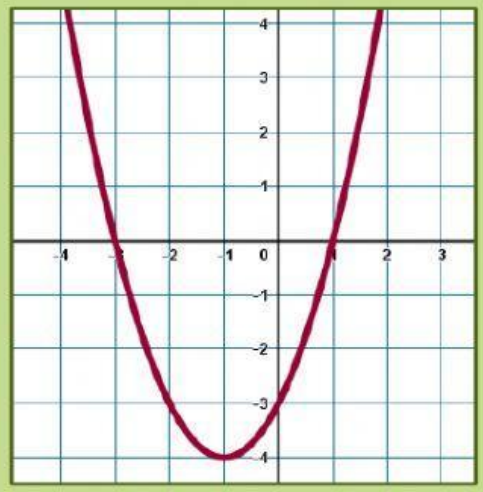

LIVEWORKSHEETS