Elina Keerpalu

KORRUTAMINE JA JAGAMINE
2. klass

1. **Arvuta. Ühenda võrdsed vastused paaridesse.**

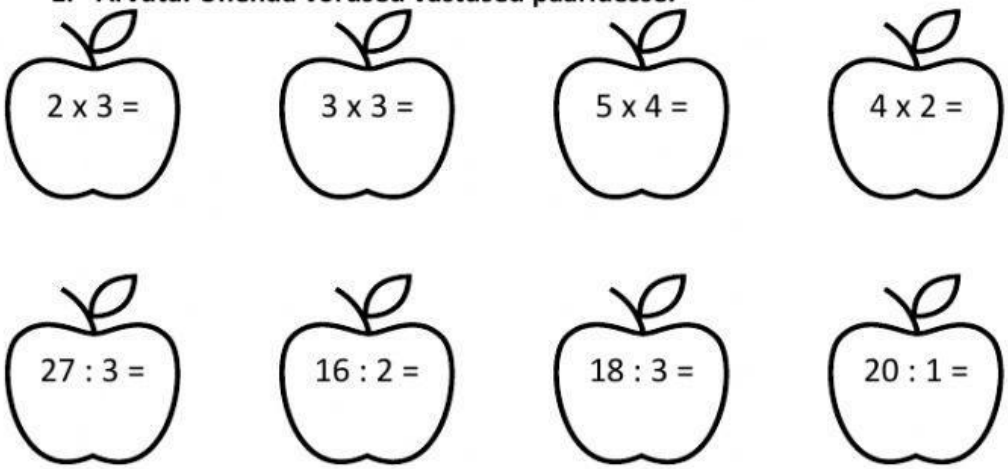

2. **Lahenda pildi põhjal ülesanne.**



3. **Annil oli 10 eurot. Ta ostis kolm kahe-eurost jäätist. Palju jäi tüdrukul raha alles?**

Tehe:

Vastus:

LIVEWORKSHEETS

4. Leia laste vanused



LIVEWORKSHEETS