ورقة عمل درس 4-4

اسم الطالب:

أوجد قيمة كل مما يلي :

x

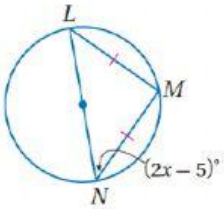

$m\widehat{DH}$

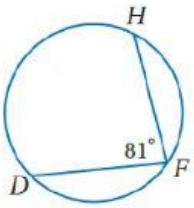

$m\angle K$

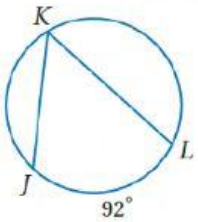

$m\angle P$

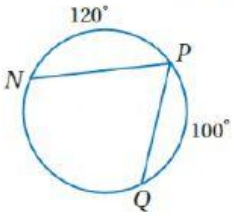

$m\angle A$

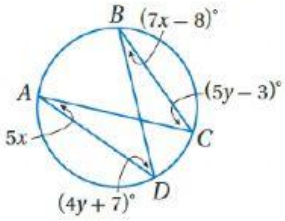

LIVEWORKSHEETS