1. Vertebrate and Invertebrate Animals



A. Complete the sentences.

1. Animals with a backbone are called _____.
2. Animals without a backbone are called _____.

2. Write the group that each invertebrate animal belongs to



3. Observe the picture and write the parts of the plant.

petal sepal anther filament
stigma style ovary

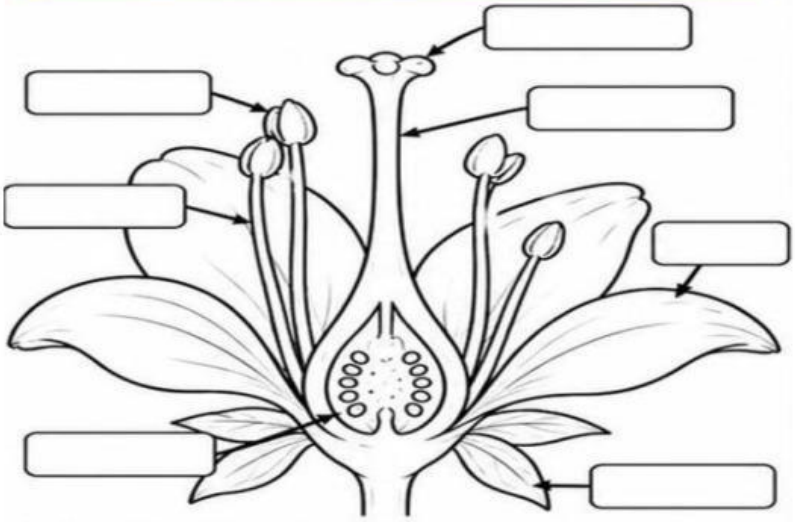

LIVEWORKSHEETS

4. **Observe the images and match the type pollinaztion to the picture**

Direct Pollination **Artificial Pollination** **Cross Pollination**

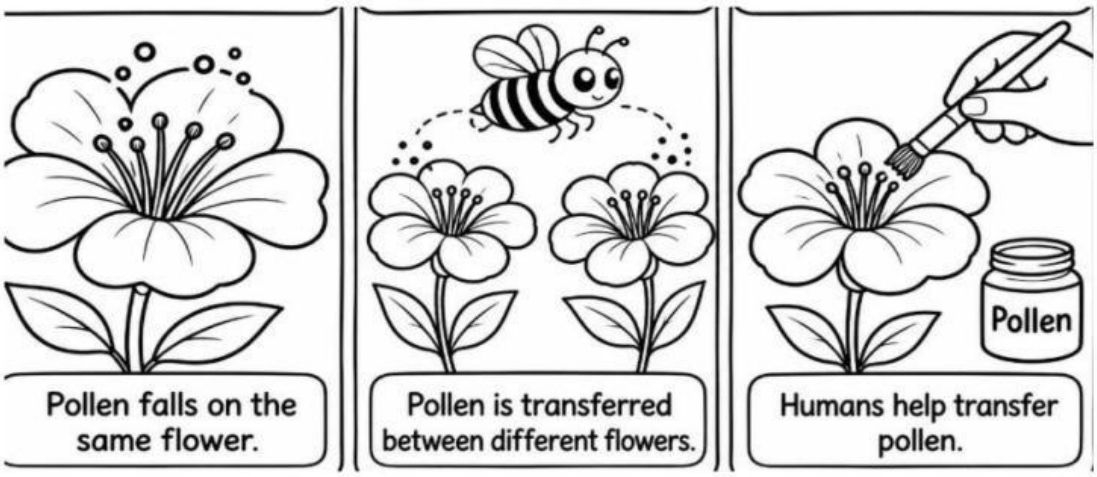

5. **Match each term with its correct definition**



A. A cheetah hunts and eats an antelope.



B. A tick feeds on the blood of an animal.



C. Penguins live together in groups for protection.



D. Two lions of the same species fight for territory.



E. Bats obtain nectar and pollinate flowers.

6. **Complete the chart of the Terrestrial Ecosystem**

LIVEWORKSHEETS

Ecosystem	Plant	Animal
 Desert		
 Grassland		
 Tropical Rainforest		
 Tundra		
 Taiga		

LIVEWORKSHEETS